# Revision Sheet 2

**Q1.**

This sentence is correct.

**10** is less than **12** ✔

**Two** of these sentences are correct.

Tick (✔) them.

**19** is more than **36**

**28** is less than **52**

**50** is more than **15**

**45** is less than **23**

**Q2.**

The numbers in the shaded squares make a sequence.

Continue the sequence by shading more squares.

| | | | | | | |
|---|---|---|---|---|---|---|
| 1 | 2 | 3 | 4 | 5 | 6 | 7 |
| 8 | 9 | 10 | 11 | 12 | 13 | 14 |
| 15 | 16 | 17 | 18 | 19 | 20 | 21 |
| 22 | 23 | 24 | 25 | 26 | 27 | 28 |
| 29 | 30 | 31 | 32 | 33 | 34 | 35 |

**Q3.**

Draw a tick (✔) on the clock which shows half past three











**Q4.**

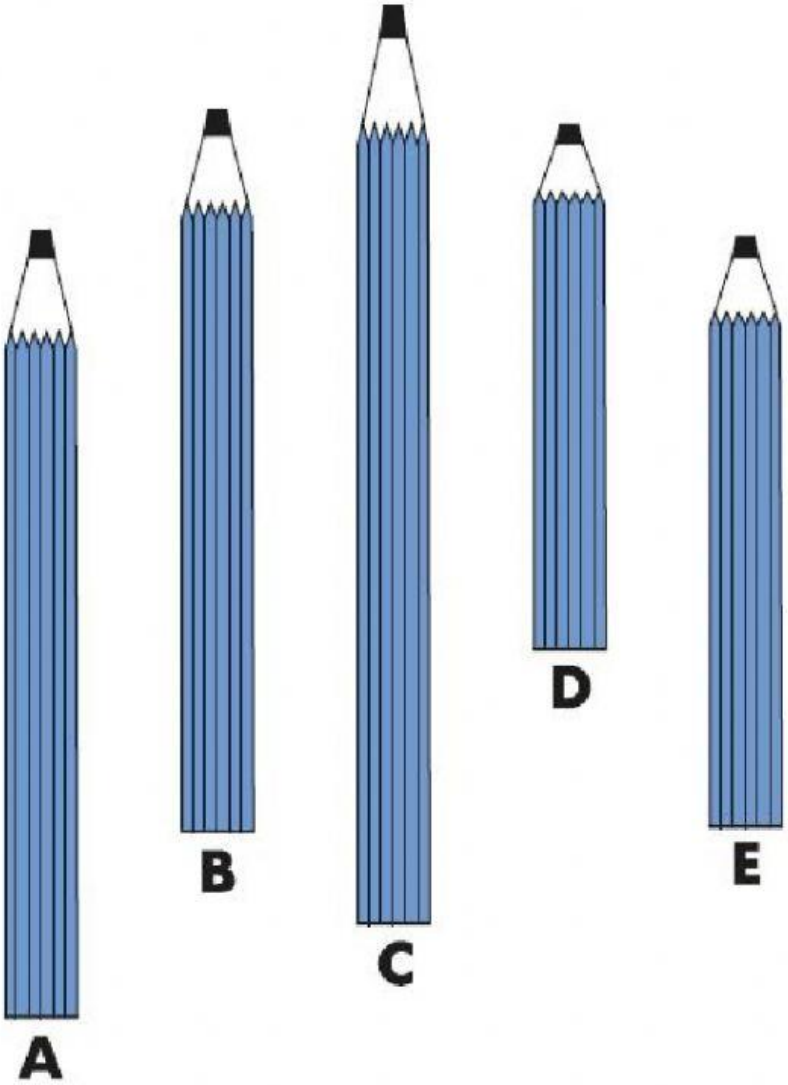


Pencil **C** is the longest pencil.

Order the rest of the pencils.

You may use a ruler.

| longest | | | | shortest |
|---|---|---|---|---|
| C | | | | D |

**Q5.**

Desi walks on all the numbers from **smallest** to **largest**.

Draw arrows (⟶) to show the path he takes.

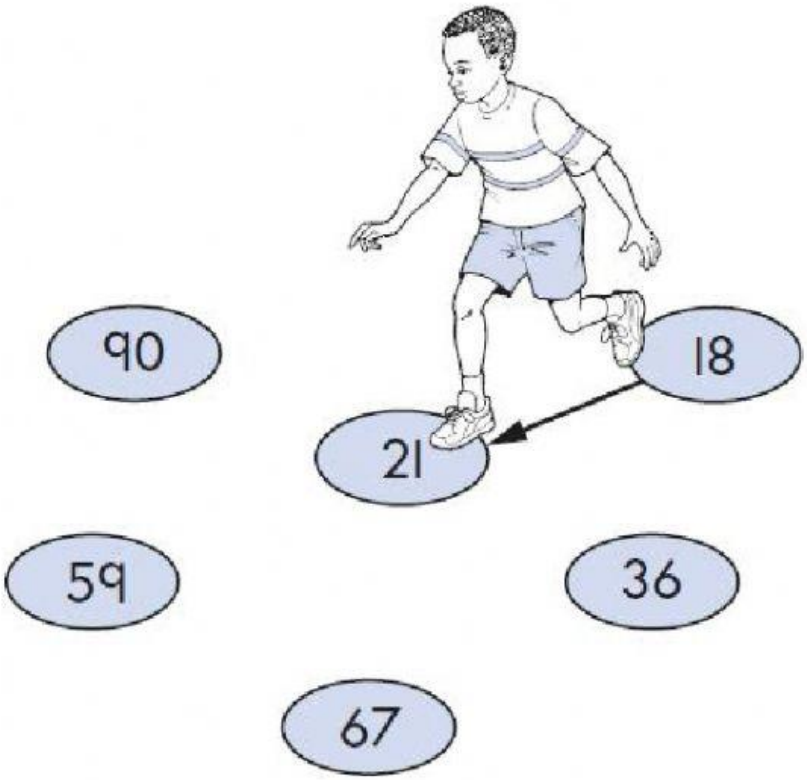

**Q6.**

Look at the chart.

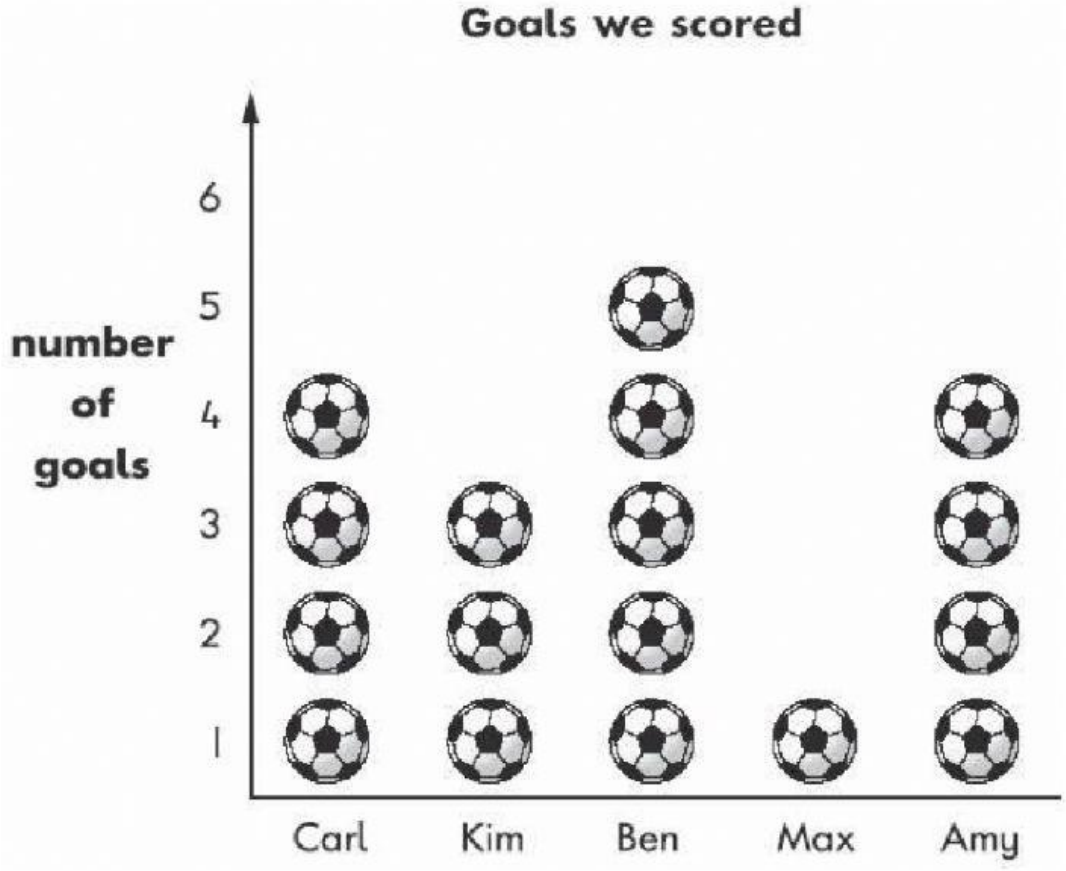


Which children scored the **same** number of goals?

| | | |
|---|---|---|
| | and | |

**Q7.**

Draw lines to match the shapes to their names.

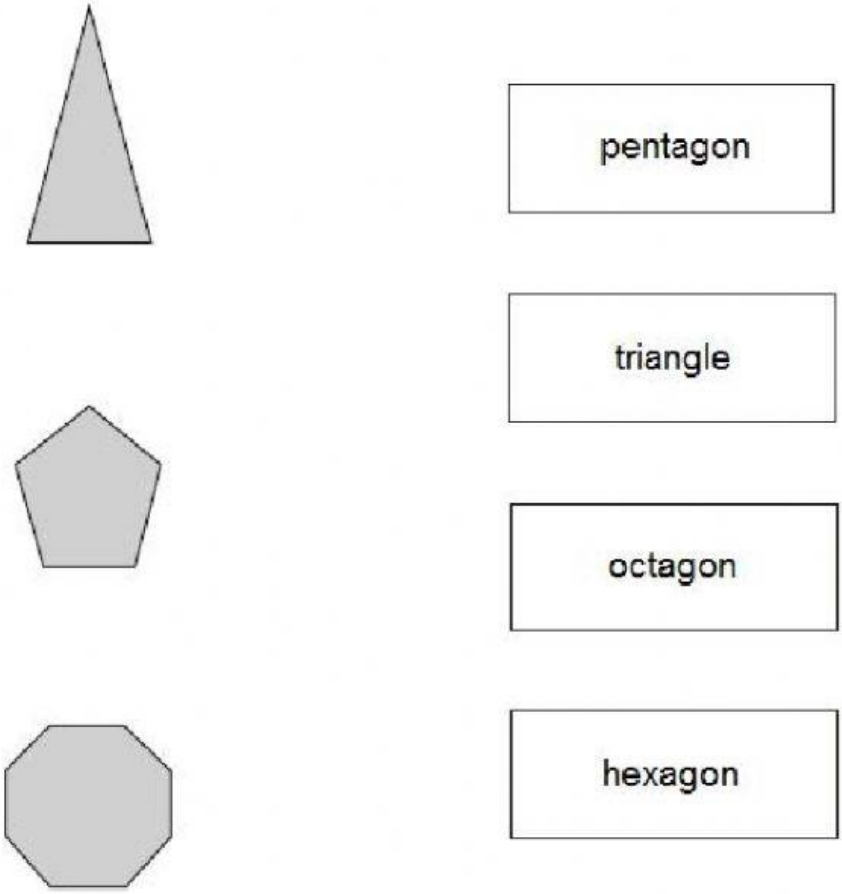

**Q8.**

Draw a ring around the person who is **11th** in the queue.



**Q9.**

Tick the two sentences that are correct.

Tick **two**.

| | |
|---|---|
| A square has sides of equal length. | ☐ |
| A square has curved sides. | ☐ |
| A square has lines of symmetry. | ☐ |
| A square has five sides. | ☐ |

**Q10.**

On these cards, the word should match the number.

**One** of these cards is wrong.
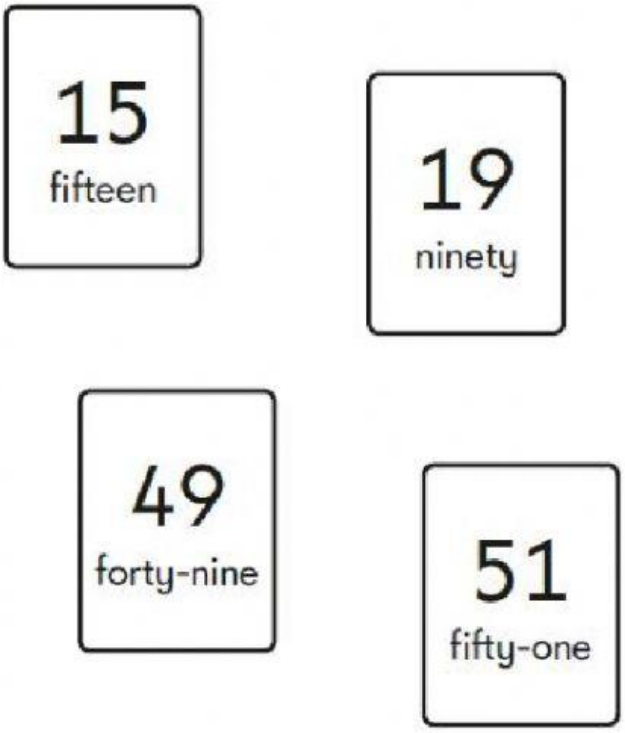
Draw a cross on the card that is wrong.