**UNIT 1: Whole Numbers 1**
**Lessons: 1, 2, 3, 4, 5**

**Name:** _____ **Date:** _____

**Q1. Count and write the number in the box.**

**a.**

**b.**



**c.**



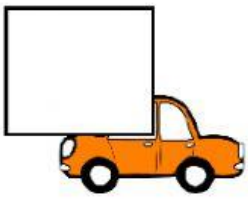

**Q2. Fill in the missing numbers.**




**Q3. Write backward counting from 20 – 11.**




**Q4. Count in 2s and write the correct answer.**

**a. How many flowers are there?**
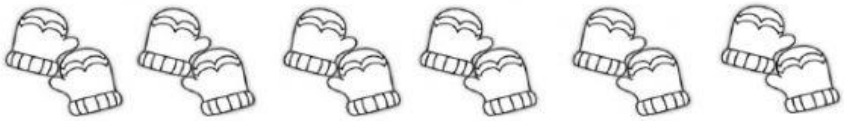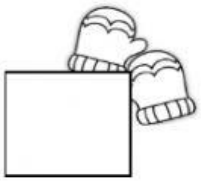
**b. How many mittens are there?**