MATH FINAL TEST PART 2

Name: _____ Class: _____

This is Math Test part 2. Make sure you did Math Test 1.

Continue on the next page

22. Which of the options below is not correct?

a. 4 kg =4000 g

b. 8 m = 8000 cm

c. 2 km = 2000 m

d. 9 L = 9000 ml

23. Look at the map. Then fill in the blanks that follow.

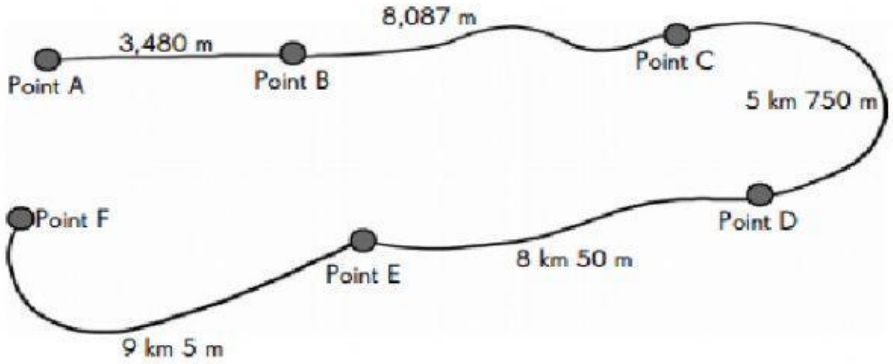

a. Point B is _____ kilometers _____ meters from Point C.

b. Point E is _____ meters from Point F.

24. Write the weight of the following:

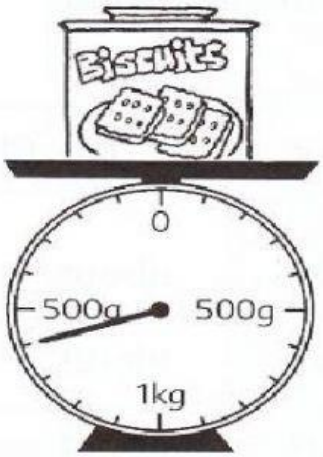

_____ kg _____ g

25. Complete the tally chart below.

Name	Tally	Number of cards
Raz		8
Ali	𝍸 I	
Ziad		10
Tamim	𝍸 𝍸 IIII	

26. Complete the bar graph below using the tally chart. Click on the correct blue boxes to create your missing bars.

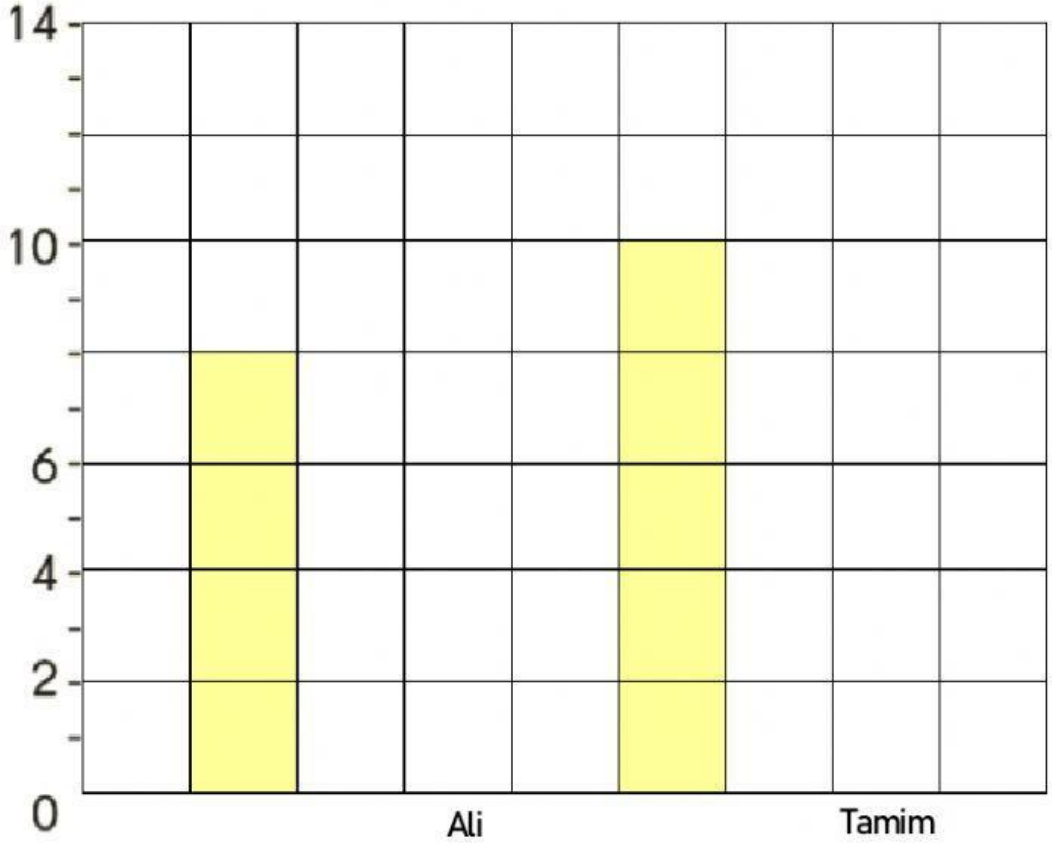

27. Write the missing numbers.

$$\frac{3}{8} = \frac{6}{} = \frac{}{24} = \frac{}{32}$$

28. Which of the fractions below is the simplest form of $\frac{24}{30}$?

a. $\frac{5}{6}$ b. $\frac{4}{5}$ c. $\frac{3}{4}$

29. Frankie has 6/9 of a pizza left. Perry eats 2/9 of the pizza. How much pizza has Frankie got now?

___

30. 3/8 of 56 apples are green. How many apples are green?

31. Tell the time using **past** or **to**.

32. Express time in hours and minutes:

85 min = h min

33. Add the hours and minutes.

2 h 15 min + 5 h 30 min =

34. Subtract the hours and minutes.

9 h 20 min - 4 h 30 min =

35. Read the word problem below. Drag and drop the elements to complete the timeline and fill out the missing information to find the elapsed time in hours and minutes.

Ringo went to school from 7:15 AM to 3:10 PM. How many hours and minutes did he spend in school?

Drag these elements into the timeline

Complete the steps below to find the elapsed time.

min + 10 min + h + h = h min

Ringo spent hours minutes in school.