Maths

VERBALLY

Numbers in tens and ones

Let's Learn

Math Lab

Picture It

a)



70 4 → 7 4

seventy-four

Tens	Ones
7	4

74 is 70 and 4.

74 = 7 tens 4 ones

b)

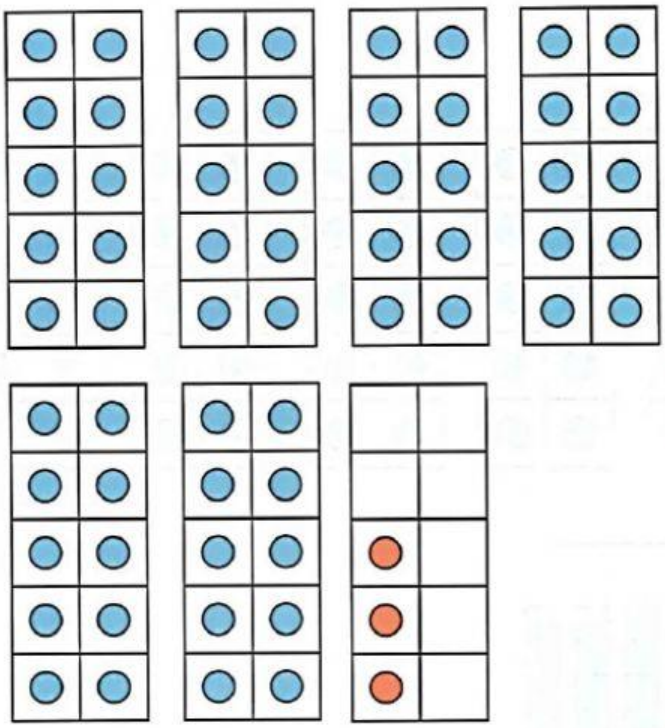

60 3

sixty-three

Tens	Ones
6	3

60 and 3 make 63.

63 = ☐ tens ☐ ones

DO

Let's Do

1. Write the numbers in tens and ones.

a)

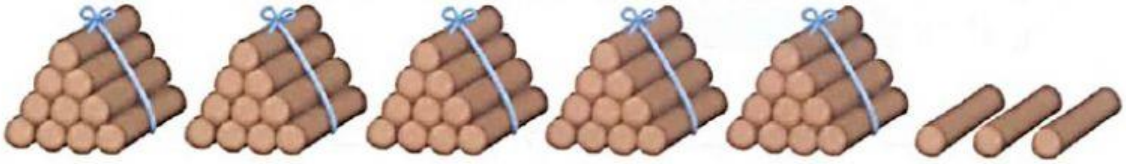

fifty-three

Tens	Ones
5	3

53 = _____ tens _____ ones

b)

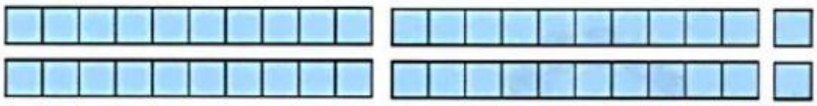

forty-two

Tens	Ones
4	2

42 = _____ tens _____ ones

2. Count the tens and ones.
Then, fill in the missing numbers.

a)



Tens	Ones

_____ tens _____ ones = _____

DO

1. Match.

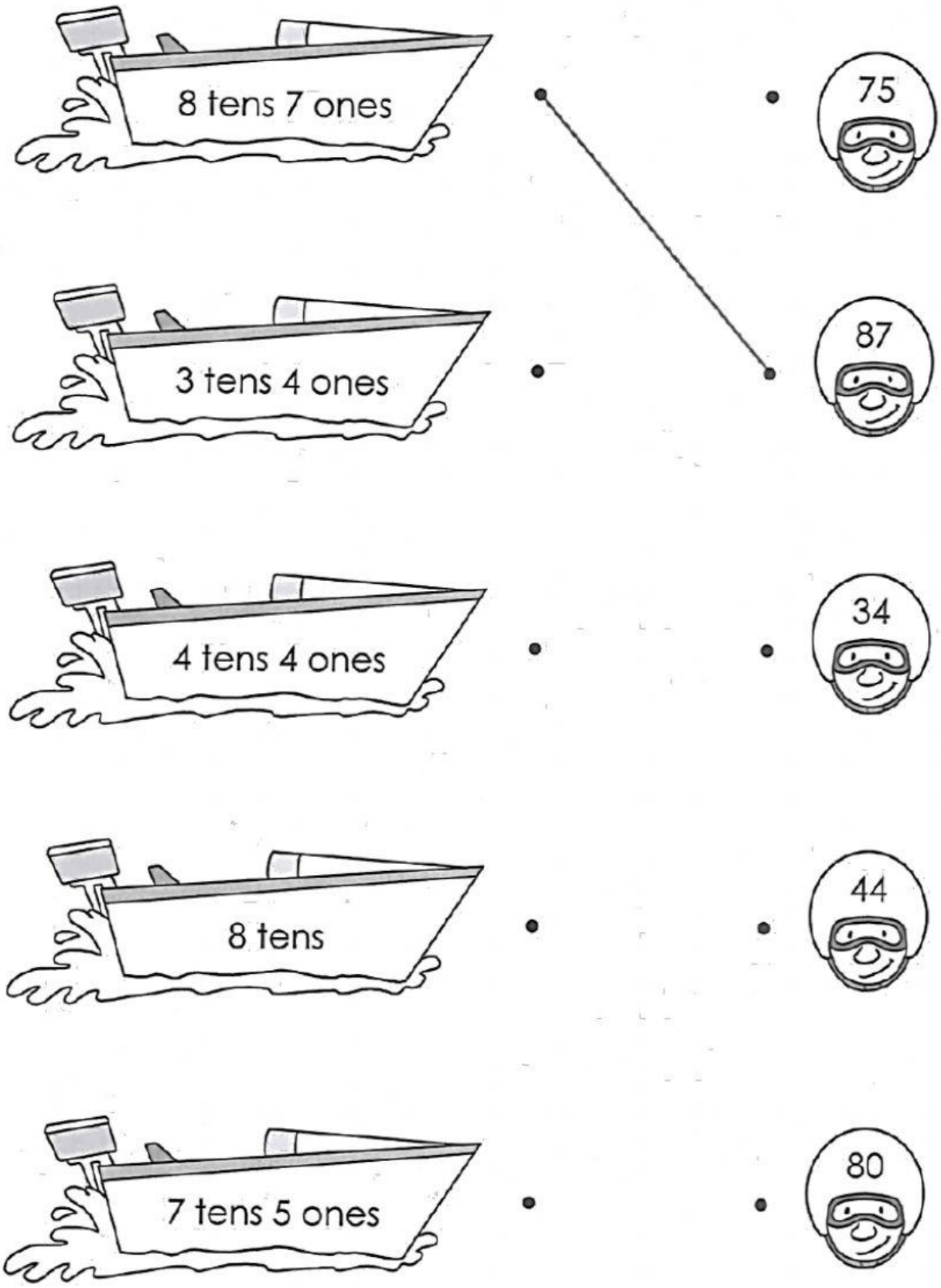
8 tens 7 ones
3 tens 4 ones
4 tens 4 ones
8 tens
7 tens 5 ones
75
87
34
44
80

DO

. How many tens and ones are there?
Fill in the missing numbers.

Example

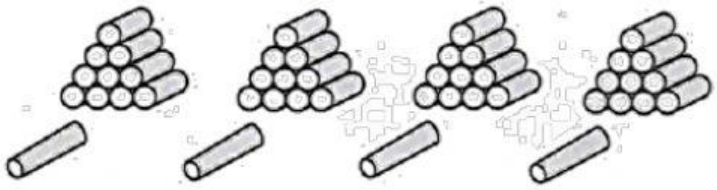

4 tens 4 ones

44

a)

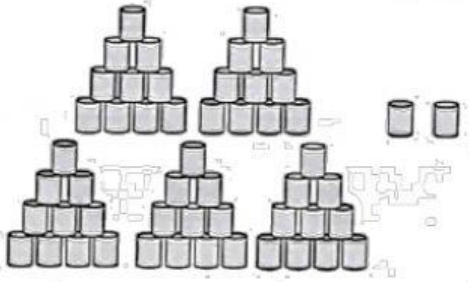

_____ tens _____ ones

b)

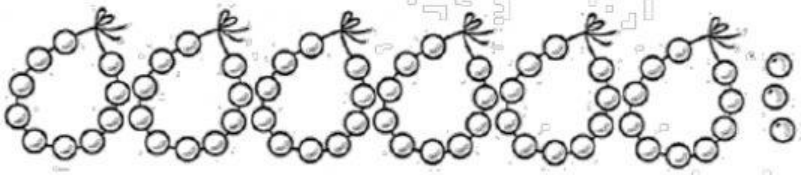

_____ tens _____ ones

c)



_____ tens _____ ones

DO

Fill in the missing numbers.

Example



Click here: