Ch – 12 Geometry (Lesson-12)		
Concept cum Practice as Exit Tickets	Grade 5 Elite Maths	United Arab Emirates Ministry of Education
Name:	Date:31/05/2020	

Learning objective – To Find the Volume of Composite Figures

Example 2

Find the volume of the composite figure.

Separate the figure into two prisms.
Find the volume of each prism.

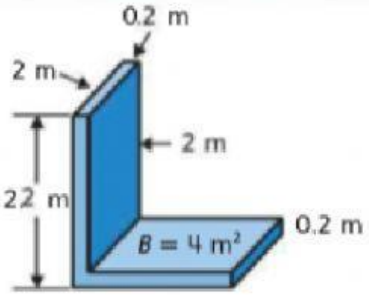

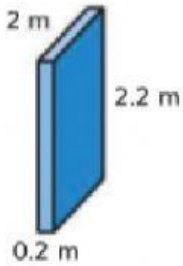

$V = \ell \times w \times h$

$V =$ ____ × ____ × ____ → $V =$ [ ]

$V = B \times h$

$V =$ ____ × ____ → $V =$ [ ]

+

Add the volumes. The total volume is _____ cubic meters, or [ ] m^3.

4.

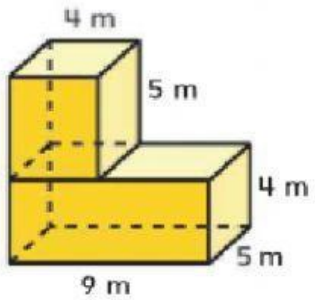

Vol of bottom prism = 9 X _____ X 4

Vol. of bottom prism = _____

Vol of top prism = 5 X _____ X 5

Vol. of top prism = _____

Vol of Composite Prism = _____ + _____

Total vol = _____ _____

5.

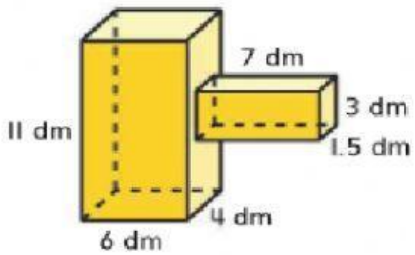

Vol of left prism = 11 X _____ X 4

Vol. of left prism = _____

Vol of right prism = 7 X _____ X 1.5

Vol. of right prism = _____

Vol of Composite Prism = _____ + _____

Total vol = _____ _____