أَوجِدْ مُحيطَ كُلِّ شَكْلٍ.

3.

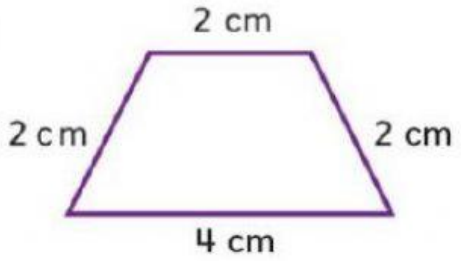

المُحيطُ هُوَ _____ سنتيمترًا.

4.

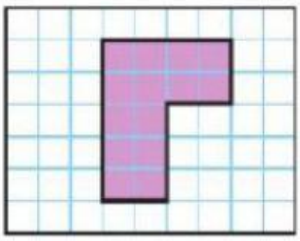

المُحيطُ هُوَ _____ وحدة.

5.

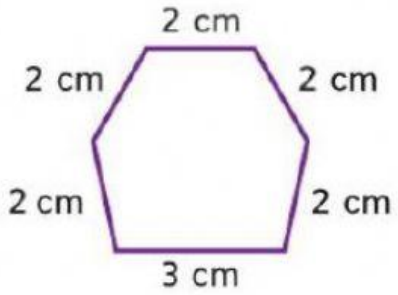

المُحيطُ هُو _____ سنتيمترًا.

6.

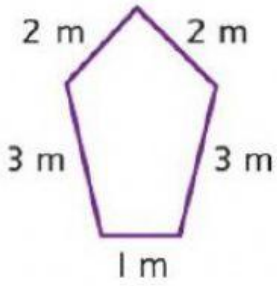

المُحيطُ هُو _____ مترًا.