Name : _____

Counting Squares

L1S1

Find the area of each shape.

= 1 square unit

1)



Area = ( ) square units

2)

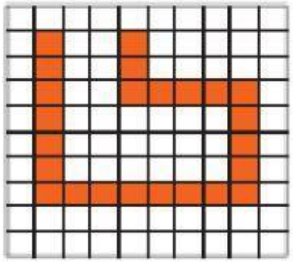

Area = ( ) square units

3)

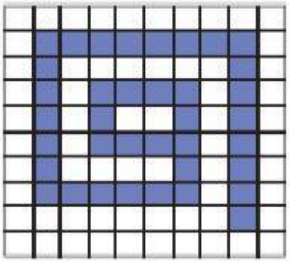

Area = ( ) square units

4)

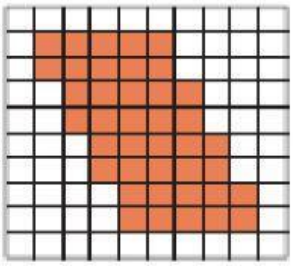

Area = ( ) square units

5)

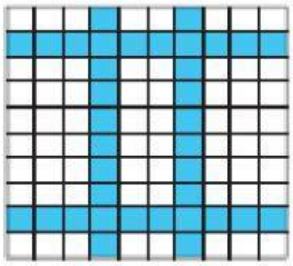

Area = ( ) square units

6)



Area = ( ) square units

7)



Area = ( ) square units

8)



Area = ( ) square units

9)



Area = ( ) square units