Determine which letter best describes the shaded portion.

1) 

A. four-fourths
B. two halves
C. one half

2)

A. four quarters
B. one half
C. one quarter

3) 

A. two halves
B. four-fourths
C. one half

4) 

A. two halves
B. one half
C. one-fourth

5) 

A. one half
B. two halves
C. two-fourths

6) 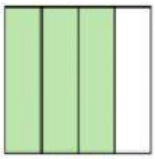

A. two halves
B. three quarters
C. one half

7) 

A. four-fourths
B. two-fourths
C. one quarter

8) 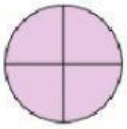

A. one quarter
B. three-fourths
C. four-fourths

9) 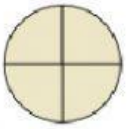

A. four quarters
B. two quarters
C. three-fourths

10) 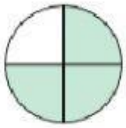

A. one half
B. three quarters
C. four-fourths

11) 

A. two-fourths
B. three quarters
C. four quarters

12)

A. three-fourths
B. one-fourth
C. four-fourths

Answers

1. _____
2. _____
3. _____
4. _____
5. _____
6. _____
7. _____
8. _____
9. _____
10. _____
11. _____
12. _____