Упражнение

1. Маркирай само числата, които могат да се делят на 7.

18	37	40	54	81	81	34	46	18	54	17
17	34	46	14	21	28	40	54	81	46	34
81	46	35	42	49	56	18	37	40	18	54
34	54	63	70	7	49	56	42	21	28	14
81	40	21	7	28	14	21	56	14	7	42
54	37	56	35	14	56	49	7	35	14	56
56	21	70	56	35	28	35	56	28	35	70
21	35	14	37	56	14	56	18	14	21	35
37	18	40	54	14	7	49	54	35	56	14
54	34	81	18	7	49	14	81	56	14	35
46	17	37	54	46	37	17	54	34	81	18

2. Попълни таблиците.

:	9
81	
27	
63	

:	2
8	
18	
16	

:	8
56	
32	
64	

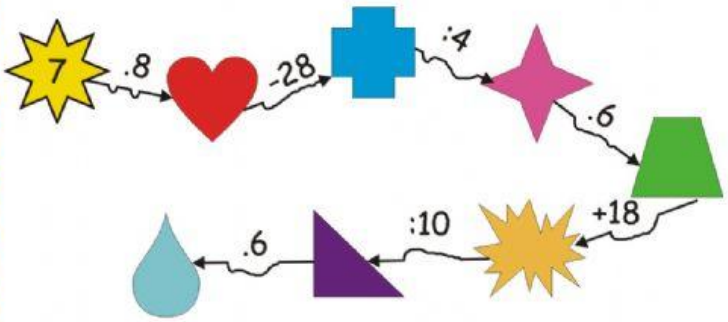

3. Във всеки аквариум трябва да плува по една рибка. Открий правилната.

4


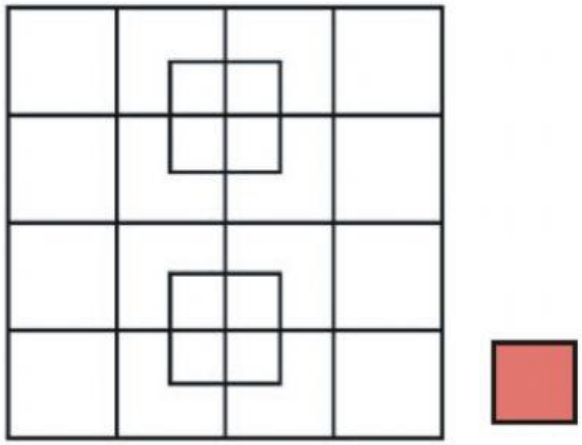
5. Колко са квадратите на чертежа?