AUTOMATICALLY MAKE INTERACTIVE HERE →

Name: _____ Year: I _____

Fraction

Equal & Unequal

How did you find the questions?

Easy ☐ Just right ☐ Hard ☐

Pick either the shape is equal or unequal. One answer for each question.

A)

equal

unequal

B)

equal

unequal

C) 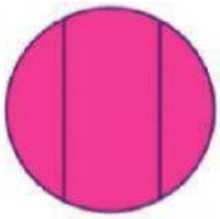

equal

unequal

D)

equal

unequal

E) 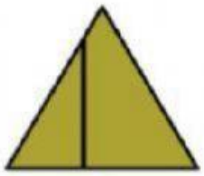

equal

unequal

F) 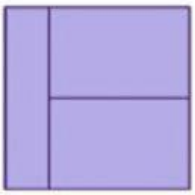

equal

unequal

G) 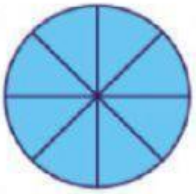

equal

unequal

H)

equal

unequal

I)

equal

unequal

J)

equal

unequal

WORKSHEETZONE

LIVEWORKSHEETS