38 Pensem en les taules (Repàs)

1. Digues quants cercles hi ha en cada cas. Recorda que has de tenir en compte els que estan ocults!



_____ X _____ = _____

_____ X _____ = _____

_____ X _____ = _____



_____ X _____ = _____



_____ X _____ = _____

_____ X _____ = _____

LIVEWORKSHEETS

Data:



_____X_____=---------

2. Completa les cel·les dels resultats, intenta fer-ho sense mirar. Recorda que hi ha multiplicacions que tenen el mateix resultat. Això pot ser una ajuda.

1×1=	1×2=	1×3=	1×4=	1×5=	1×6=	1×7=	1×8=	1×9=
2×1=	2×2=	2×3=	2×4=	2×5=	2×6=	2×7=	2×8=	2×9=
3×1=	3×2=	3×3=	3×4=	3×5=	3×6=	3×7=	3×8=	3×9=
4×1=	4×2=	4×3=	4×4=	4×5=	4×6=	4×7=	4×8=	4×9=
5×1=	5×2=	5×3=	5×4=	5×5=	5×6=	5×7=	5×8=	5×9=
6×1=	6×2=	6×3=	6×4=	6×5=	6×6=	6×7=	6×8=	6×9=
7×1=	7×2=	7×3=	7×4=	7×5=	7×6=	7×7=	7×8=	7×9 =
8×1=	8×2=	8×3=	8×4=	8×5=	8×6=	8×7=	8×8=	8×9=
9×1=	9×2=	9×3=	9×4=	9×5=	9×6=	9×7=	9×8=	9×9=
10×1=	10×2=	10×3=	10×4=	10×5=	10×6=	10×7=	10×8=	10×9=

LIVEWORKSHEETS