Unsur-unsur kubus, balok, prisma dan limas



Name: _____

Class: _____

LIVEWORKSHEETS

I. Perhatikan gambar di bawah ini, kemudian amatilah bentuk pada gambar tersebut.

Sebutkan dan ada berapakah unsur-unsur yang ada pada gambar tersebut !

Titik sudut :
Sisi :
Bidang samping :
Diagonal ruang :
Diagonal sisi :
Luas diagonal :

LIVEWORKSHEETS



Titik sudut :

Sisi :

Bidang samping :

Diagonal ruang :

Diagonal sisi :

Luas diagonal :

LIVEWORKSHEETS

Titik sudut :
Sisi :
Bidang samping :
Diagonal ruang :
Diagonal sisi :
Luas diagonal :

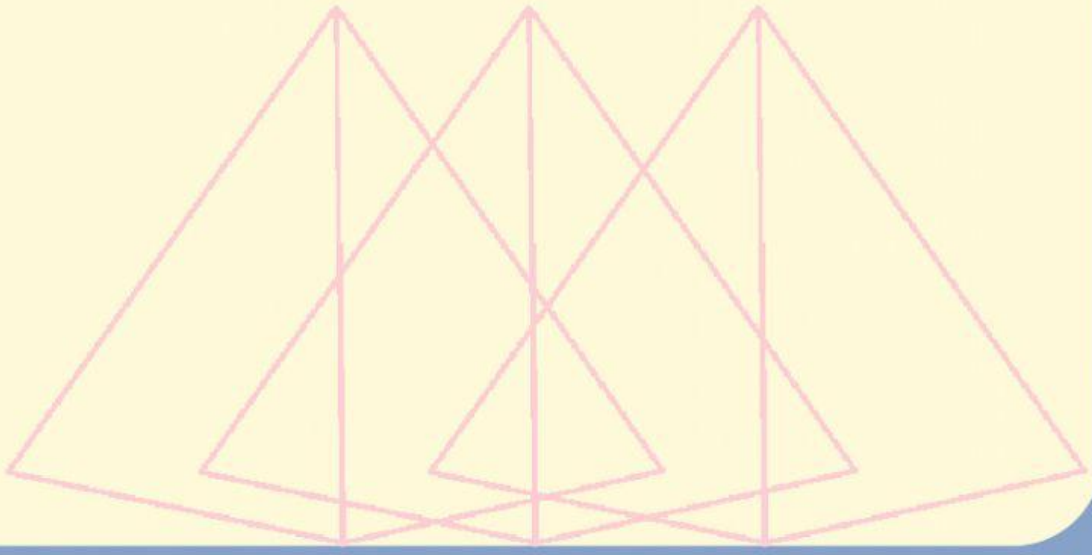

LIVEWORKSHEETS

Titik sudut :

Sisi :

Bidang samping :

Diagonal ruang :

Diagonal sisi :

Luas diagonal :



LIVEWORKSHEETS