Single Probability

1. How many pieces are there total in the spinner?
2. If you spun the spinner 1 time, what is the probability it would land on a white piece?
3. If you spun the spinner 1 time, what is the probability it would land on a black piece?

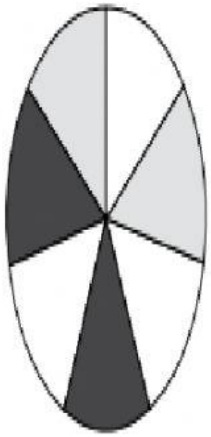

1. How many pieces are there total in the spinner?
2. If you spun the spinner 1 time, what is the probability it would land on a blue piece?
3. If you spun the spinner 1 time, what is the probability it would land on a white piece?

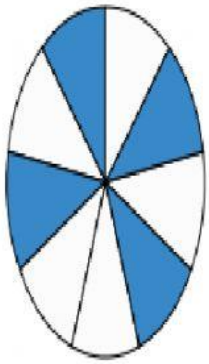

1. How many pieces are there total in the spinner?
2. If you spun the spinner 1 time, what is the probability it would land on a blue piece?
3. If you spun the spinner 1 time, what is the probability it would land on a white piece?

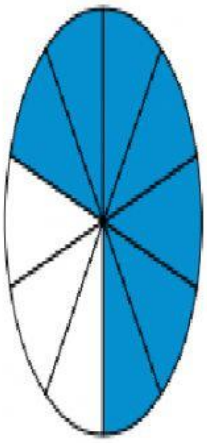

LIVEWORKSHEETS