Codeyoung

Concept CW_Grade-7_Perimeter and Area

Advanced Problems on Perimeter and Area

Find the perimeter of each shape.

1)

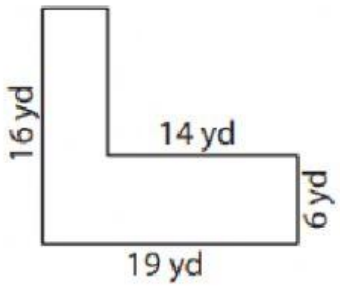

Perimeter = _____ yd

2)

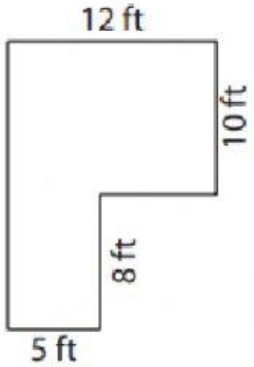

Perimeter = _____ ft

3)

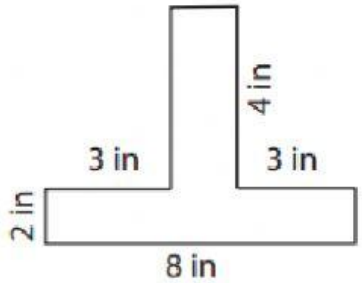

Perimeter = _____ in

4)

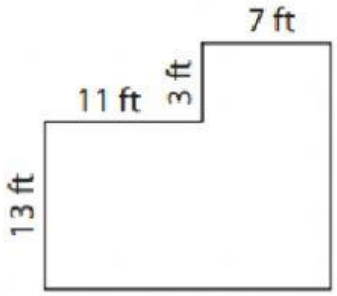

Perimeter = _____ ft

5)

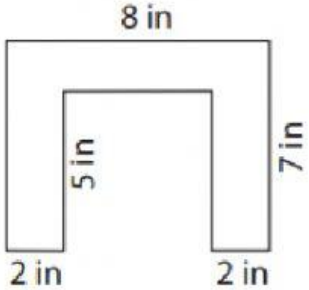

Perimeter = _____ in

6)

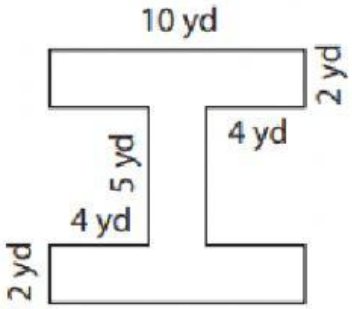

Perimeter = _____ yd

7)

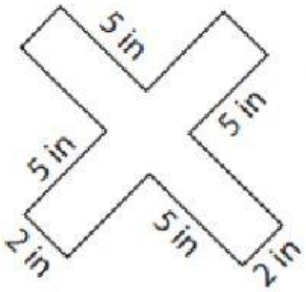

Perimeter = _____ in

8)

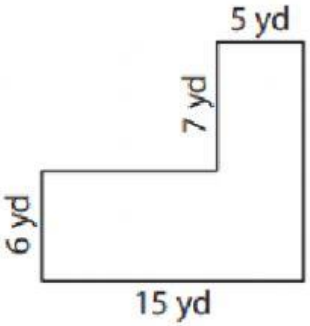

Perimeter = _____ yd

9)

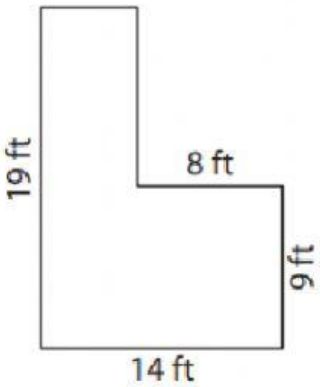

Perimeter = _____ ft

LIVEWORKSHEETS
LIVEWORKSHEETS

Codeyoung

Find the area of each figure.

1)

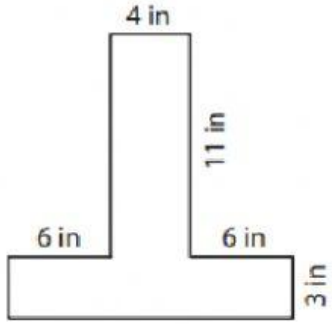

Area = _____ in^2

2)

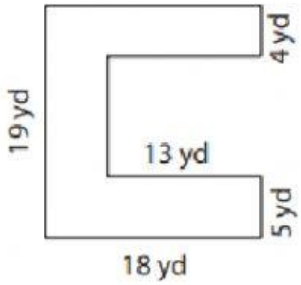

Area = _____ yd^2

3)

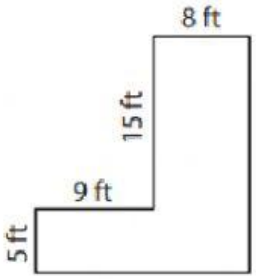

Area = _____ ft^2

4)

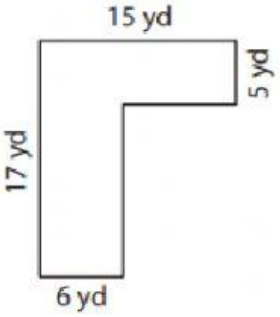

Area = _____ yd^2

5)

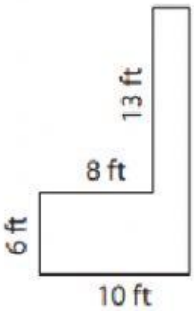

Area = _____ ft^2

6)

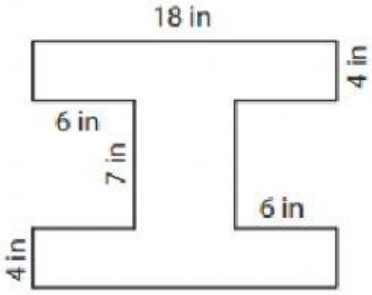

Area = _____ in^2

7)

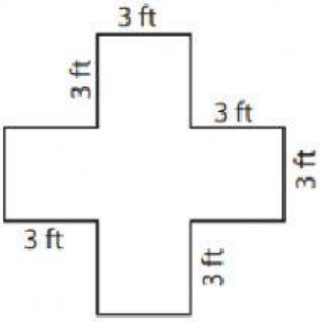

Area = _____ ft^2

8)

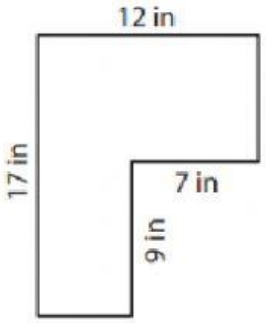

Area = _____ in^2

9)

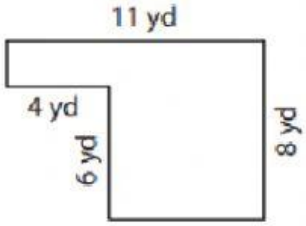

Area = _____ yd^2

LIVEWORKSHEETS
LIVEWORKSHEETS