Area of a Circle

- Remember you will need the radius to help you find the area of a circle.

$$A = \pi r^2$$

- don't add extra spaces
- Don't forget units!
- Use ^2 for units^2

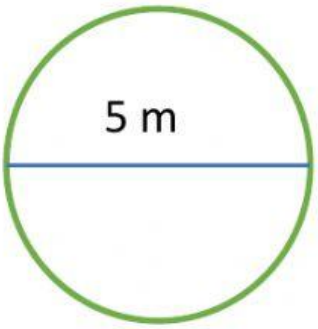

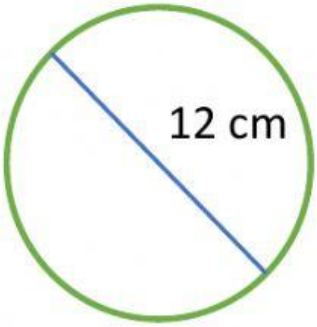

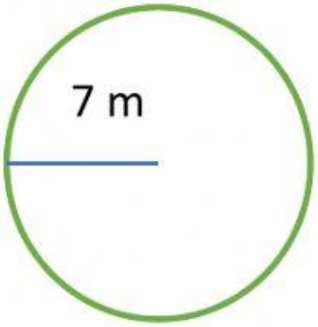

1) A=pixr^2	2)	3)
=		
=		

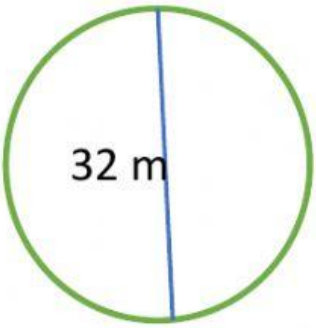

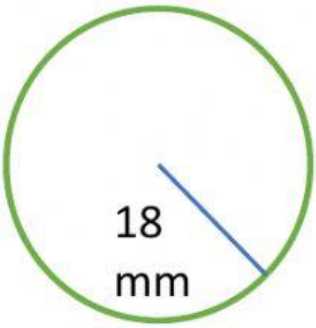

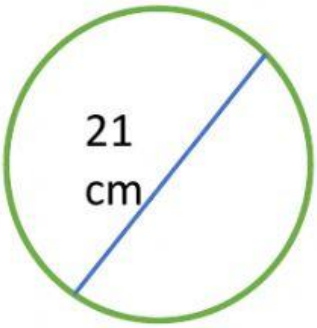

4)	5)	6)

If the area of a circle is 78.5m^2. What is the diameter? What is the radius?

D=	R=

LIVEWORKSHEETS