Congruent or similar

Identifying Similar and Congruent Shapes Name:

Determine if the shapes shown are 'similar', 'congruent' or 'neither'.

1)

2)

3)

4)
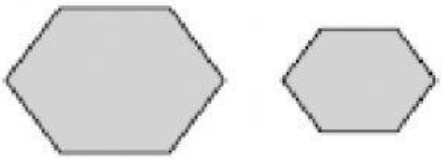

5)

6)
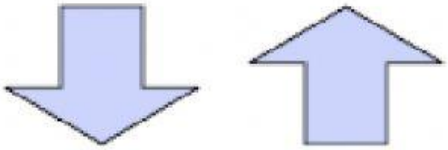

7)

8)

9)
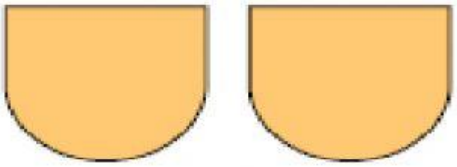

10)

11)
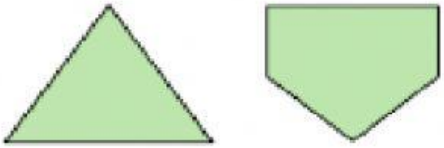

12)
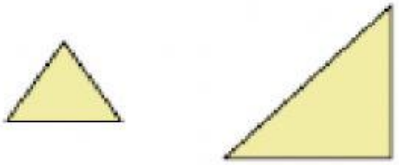

13)
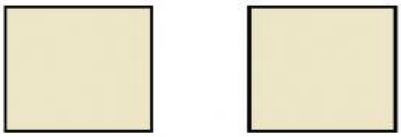

14)
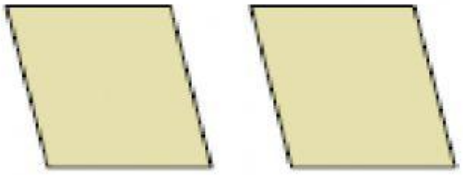

15)

16)

LIVEWORKSHEETS