Matemática

Nome: _____

Data: ___- ___ - _____

1. **Observa** os ábacos. **Escreve** a leitura por extenso dos números representados.

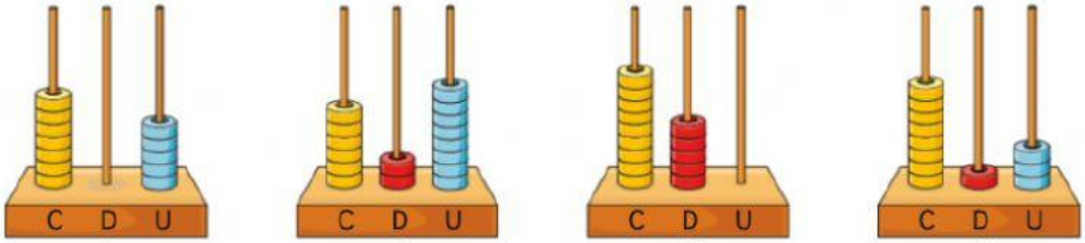

A B C D

A _____

B _____

C _____

D _____

2. **Compõe** os números. **Observa** o exemplo.

$(5 \times 100) + (3 \times 10) + (4 \times 1) =$ 534

$(8 \times 100) + (5 \times 10) + (7 \times 1) =$ _____

$(6 \times 100) + (4 \times 10) =$ _____

$(9 \times 100) + (7 \times 1) =$ _____

3. **Completa** tendo em conta os valores das setas.

o dobro

1	
5	
10	
20	

o quádrulo

2	
4	
10	
20	

o quíntuplo

2	
4	
10	
20	

4. **Escreve** a multiplicação correspondente a cada uma das imagens.



___ × ___ = ___
ou
___ × ___ = ___



___ × ___ = ___
ou
___ × ___ = ___

___ × ___ = ___
ou
___ × ___ = ___

LIVEWORKSHEETS