math Antics Worksheets

Name:

Date:

Finding the Area of Quadrilaterals

AREA 1

Instructions: Find the area of each square or rectangle using the formula: $A = L \times W$.

1

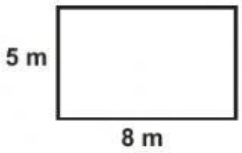

$A = 5 \times 8 = 40\ m^2$

2



3

4

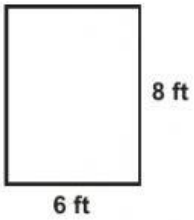

5

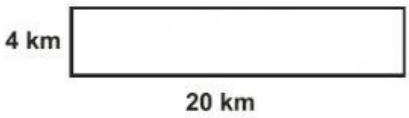

6

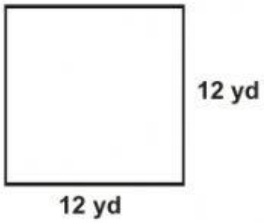

7

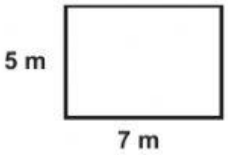

8

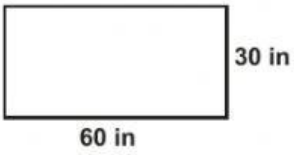

© 2014 Math Plus Motion, LLC

LIVEWORKSHEETS