Keliling Persegi dan Persegi Panjang

Hitunglah keliling persegi dan persegi panjang di bawah ini!

Persegi



=



=



=

Ikuti cara mengerjakan contoh soal 1.2!

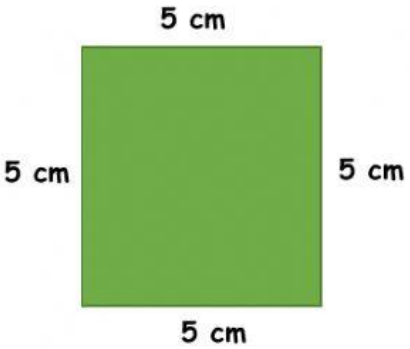

=

Ikuti cara mengerjakan contoh soal 1.3!



=

LIVEWORKSHEETS

Persegi panjang



=

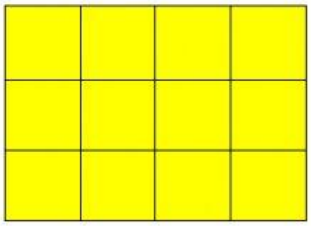

=



=

Ikuti cara mengerjakan contoh soal 2.2!

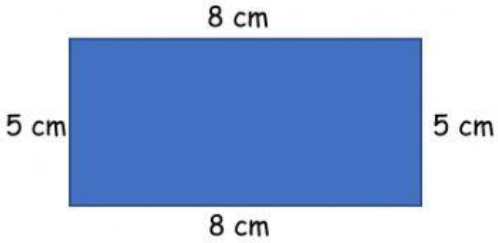

=

Ikuti cara mengerjakan contoh soal 2.3!

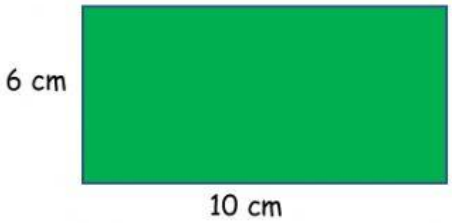

=

LIVEWORKSHEETS

LIVEWORKSHEETS