SOLUTIONS OF SYSTEMS OF LINEAR INEQUALITIES

Graph the given linear inequality. Determine which of the following points would be considered solutions for the given inequality.

Drag and Drop Activity

$y > -2x + 4$ $y \leq -\frac{1}{2}x - 1$	$y \leq x - 3$ $y \geq -\frac{2}{3}x + 2$	$y < \frac{3}{2}x + 3$ $y < \frac{1}{3}x + 3$

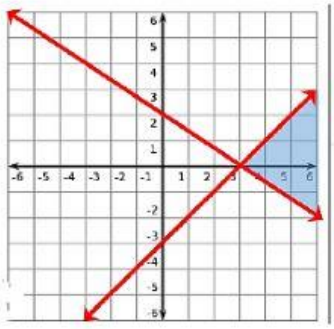

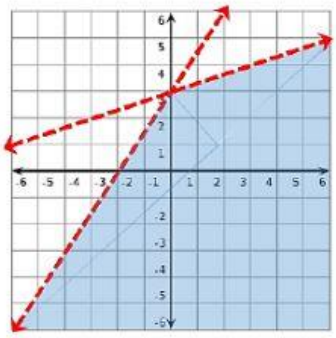

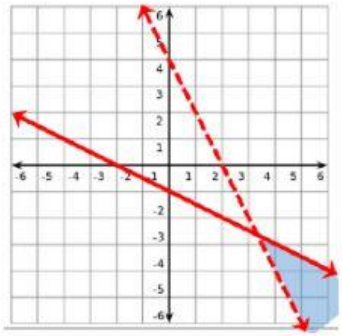

A) $(6, -1)$	B) $(3, 0)$	C) $(3, 4)$	D) $(5, -5)$	E) $(-5, -6)$	F) $(6, -4)$
G) $(4, -4)$	H) $(-1, -5)$	I) $(-4, 3)$	J) $(5, 2)$	K) $(0, 0)$	L) $(0, 3)$

LIVEWORKSHEETS