Progresiones aritméticas

En cada ítem se dan los tres primeros términos de una progresión aritmética (a_m).Halla el termino general de dicha progresión, y calcula el termino a_m que se indica

$$\mathbf{1, 5, 9, \dots, a_{10} =}$$

$u_{n+1} =$

$a_{10} =$

$$\mathbf{-20, -15, -10, \dots, a_{15} =}$$



$u_{n+1} =$

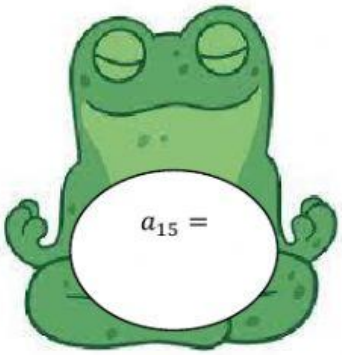

$a_{15} =$

$$\mathbf{1-\sqrt{2}, 1, 1+\sqrt{2}, \dots, a_8}$$

$u_{n+1} =$

$a_8 =$

LIVEWORKSHEETS

$$\frac{1}{2}, 1, \frac{3}{2}, \dots, a_{20} =$$

$u_{n+1} =$



$a_{20=}$

Anahi G, Yamandi S, Maywa M

LIVEWORKSHEETS