REPRESENTACIÓ DE FRACCIONS

$\frac{4}{6}$ 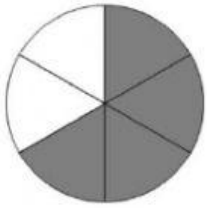

$\frac{1}{5}$ 

$\frac{2}{3}$ 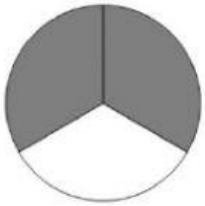

Escriu la fracció:

_____

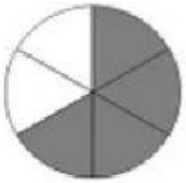 _____

 _____

_____

_____

_____

_____

_____

_____

_____

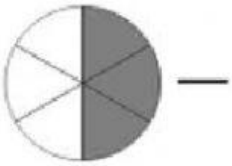 _____

_____

LIVEWORKSHEETS