Athena Global School

Grade 4

Mixed numbers

Date:_____ Name:_____

Tip: **Mixed numerals** are a mix of whole numbers and fractions.

Write the **mixed numeral** for the following:

A.

$2\frac{1}{2}$

B.

_____

C.

_____

D.

_____

E.

_____

F.

_____

G. 

_____

H.

_____

I.

_____

J. 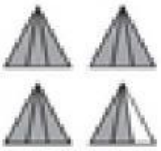

_____

LIVEWORKSHEETS

Representing Fractions

5 halves

Show on a number line

0 1 2 3

Improper fraction

$\frac{5}{2}$

Mixed number

$2\frac{1}{2}$

____ thirds

Show on a number line

0 1 2 3

Improper fraction

Mixed number

____ sixths

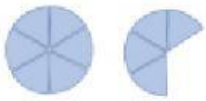

Show on a number line

0 1 2 3

Improper fraction

Mixed number

____ quarters

Show on a number line

0 1 2 3

Improper fraction

Mixed number

____ eighths

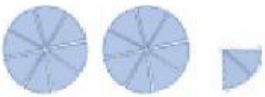

Show on a number line

0 1 2 3

Improper fraction

Mixed number

____ halves

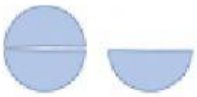

Show on a number line

0 1 2 3

Improper fraction

Mixed number

LIVEWORKSHEETS

LIVEWORKSHEETS