SECTION A

1. 7 hundreds and 3 ones is the same as _____.

(1) 73

(2) 703

(3) 730

(4) 731

---

2. The figure below is made up of 8 identical triangles. What fraction of the figure is not shaded?

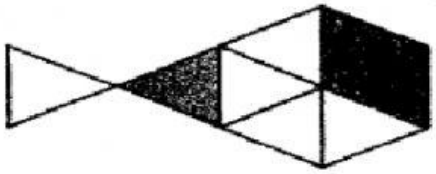

(1) $\frac{2}{5}$

(2) $\frac{3}{5}$

(3) $\frac{3}{8}$

(4) $\frac{5}{8}$

3. Which one of the following sets of numbers is arranged from the smallest to the greatest?

	smallest			greatest
(1)	962,	926,	692,	629
(2)	962,	692,	926,	629
(3)	629,	692,	926,	962
(4)	629,	926,	692,	962

LIVEWORKSHEETS

4. Based on what is shown in the diagram, what is the length of the comb?



(1) 12 cm

(2) 10 cm

(3) 6 cm

(4) 4 cm

---

5. Divide 45 by 5.

(1) 8

(2) 9

(3) 50

(4) 40

LIVEWORKSHEETS

SECTION B

1	Write eight hundred and fifty-seven in numerals. Ans: _____
2	Look at the number pattern below. What is the missing number in the pattern? 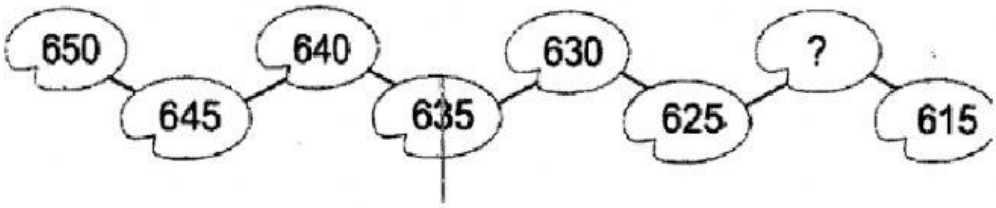 Ans:
3	The figure is made up of 10 identical rectangles. How many more such rectangles must be shaded so that $\frac{7}{10}$ of the figure is shaded? 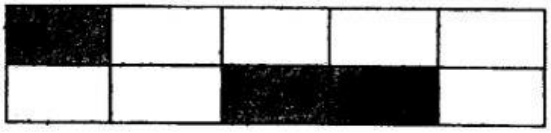 Ans:_____

LIVEWORKSHEETS

4	What is the missing digit in the box below? $$\begin{array}{r} 5\ 6\ 2 \\ +\ 3\ \boxed{?}\ 5 \\ \hline 9\ 5\ 7 \\ \hline \end{array}$$ Ans:_____
5	Carol started her class at half past 10 in the morning. Her class lasted for an hour. What time did her class end? Ans:_____ a.m

LIVEWORKSHEETS