Name: _____ Class: _____ Date: _____

CHAPTER 9

Length

Practice 1 Measuring in Metres

(1) Look at the pictures.
Fill in the blanks with **more** or **less**.

(a)



The length of the rope is _____ than 1 m.

(b)

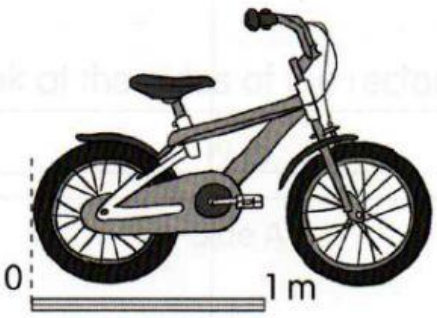

The length of the bicycle is _____ than 1 m.

(c)

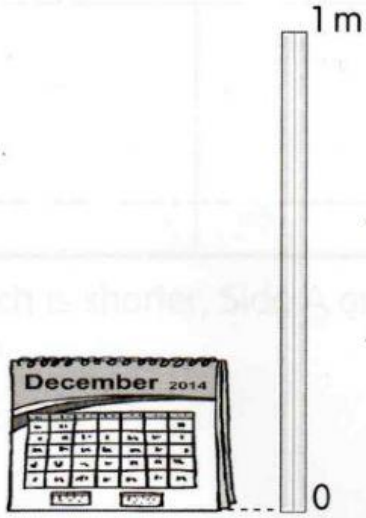

The height of the calendar is _____ than 1 m.

© 2014 Marshall Cavendish Education Pte Ltd

LIVEWORKSHEETS

(2) Look at the table below.
Tick (✔) the columns that are true.
You will need a metre stick or a 1-metre string to measure some items.

Object	Less Than 1 m	More Than 1 m
Classroom whiteboard 		
Desk		
Computer monitor		
Dustbin 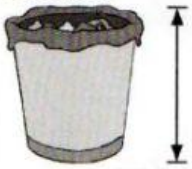		

© 2014 Marshall Cavendish Education Pte Ltd

LIVEWORKSHEETS