# *Geometry —Angles*

1) Tick the correct angle.

| | |
|---|---|
| 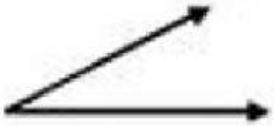 | a) Right angle |
| | b) Obtuse angle |
| | c) Straight angle |
| | e) Acute angle |
| | |
| 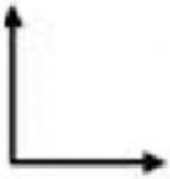 | a) Exactly 180 º |
| | b) 90 º |
| | c) more than 90 º but less than 180 º |
| | d) more than 0 º but less than 90 º |
| | |
| 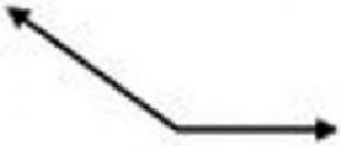 | a) |
| | b) |
| | c) |
| | d) |
| | a) |



b)

c)

e)

2) Fill in the blanks.

a) When two rays have a common endpoint they form _____.

b) The middle letter is always the _____ of the angle.

c) Angles that are less than a right angle are called _____angles.

d) Angles that are more than a right angle are called _____angles.

e) Straight angle measures exactly _____ $^{o}$ degree.

3) Who am I ? Drag the correct option for the answer.

a) Which angle is measured in me?

b) What is the angle, measured for my mouth ?

c) A spider has caught me in its web ? Which angle am I ?

*Acute angle* *Obtuse angle* *Right angle*