BEREAN CHRISTIAN ACADEMY

3rd Monthly Exam in K -1 Math

I. Directions: Circle the correct numeral/ number symbol.

1. 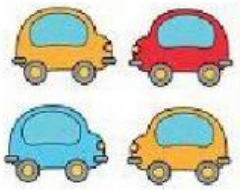

4 5

2.

2 3

3. 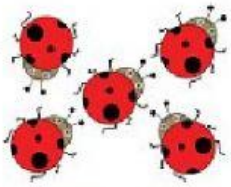

6 5

4.

2 3

5. 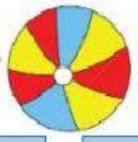

1 0

6.

3 4

II. Directions: Write down the correct numeral/ number symbol.

7. 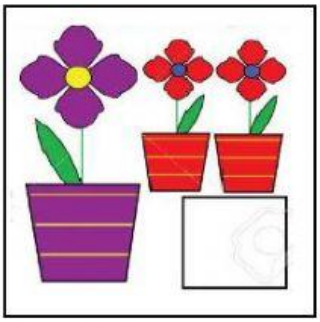

8. 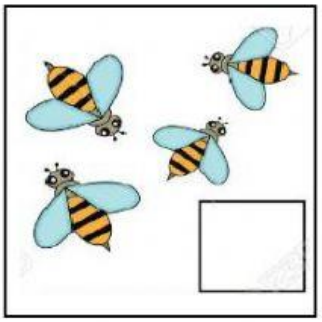

9. 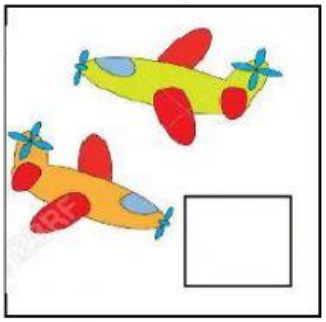

10. 

11. 

12. 

LIVEWORKSHEETS

III. Directions: Count how many apples inside the basket and match it to its number word and symbol.

1		two
3		zero
0		one
2		three

LIVEWORKSHEETS