Divide Decimals

Instructions: Show all steps in dividing the following decimal numbers.

1. $0.5\overline{)5.246}$
2. $1.6\overline{)7.124}$
3. $6.208 \div 1.6$
4. $0.56 \div 0.02$

Rewrite with the decimal moved, then solve:

1.
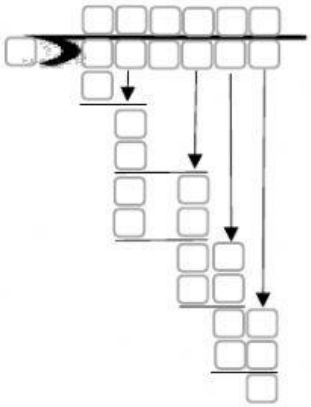

2.
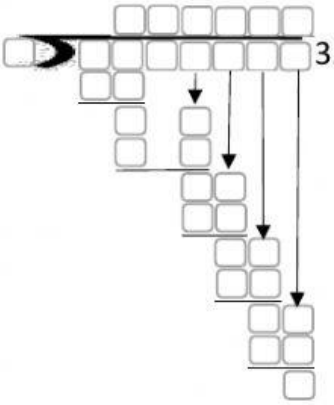

3.
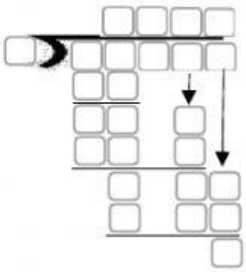

4.
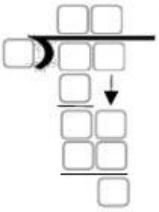

LIVEWORKSHEETS