PUSHPALATA VIDYA MANDIR

MATHS LIVE WORKSHEET

Std: 1 Date: _____

Name: _____

Count the pictures. Match the numbers with their number names.



4

five



5

three

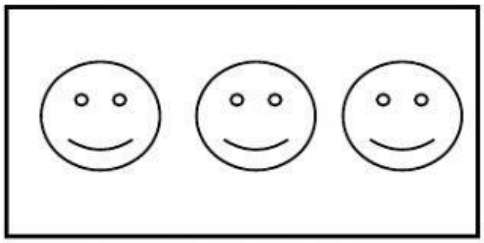

3

four



1

two



2

one