More than less than

More:

100 more than 65 is_____

105 more than 70 is_____

120 more than 85 is_____

50 more than 40 is_____

250 more than 40 is_____

Less:

70 less than 100 is_____

80 less than 200 is_____

70 less than 180 is_____

100 less than 300 is_____

80 less than 100 is_____

LIVEWORKSHEETS

3D Shapes

Shapes	Faces	Edges
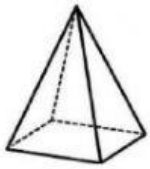		
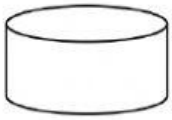		
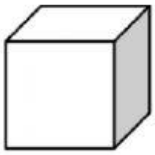		

LIVEWORKSHEETS