ESCOLA: _____

NOME:_____ **DATA:**___/___/___

SISTEMA MONETÁRIO

OBSERVE A QUANTIA DE CADA CRIANÇA E RESOLVA.

1- QUEM TEM MAIS DINHEIRO?

2- QUANTO TEM DAVI?

LIVEWORKSHEETS

3- QUANTO LUANA TEM A MAIS DO QUE DAVI?

4- QUANTO FALTA PARA DAVI COMPLETAR 100 REAIS?

5- QUANTO AS DUAS CRIANÇAS TÊM JUNTAS?

OBSERVE AS QUANTIAS EM DINHEIRO E MARQUE O QUE POSSO COMPRAR.



LIVEWORKSHEETS

TENHO ⇨

POSSO COMPRAR:

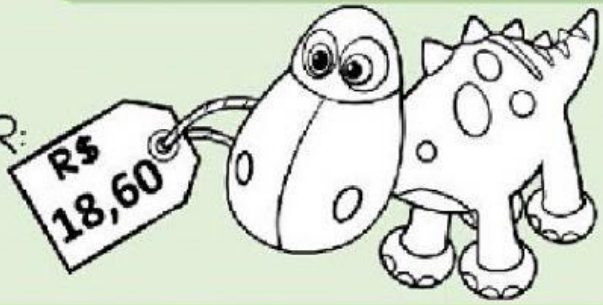

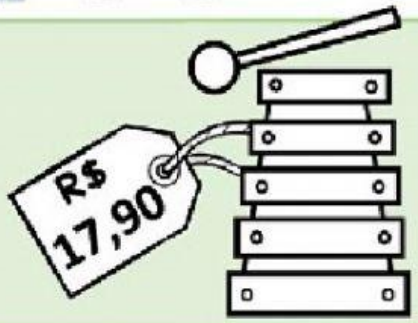

TENHO ⇨

POSSO COMPRAR:



TENHO ⇨

POSSO COMPRAR:



LIVEWORKSHEETS