Ψηλό - κοντό

Βρες κάθε φορά το πιο κοντό



LIVEWORKSHEETS

Ψηλό - κοντό

Βρες κάθε φορά το πιο ψηλό





LIVEWORKSHEETS

Ψηλό - κοντό

Βρες κάθε φορά το πιο ψηλό



Which building is taller? Circle it.



Which grass is shorter? Circle it.



Which tree is taller? Circle it.

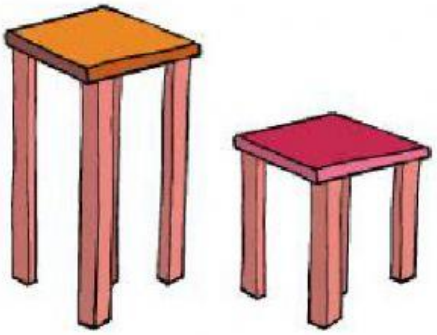

Which table is shorter? Circle it.

Which mountain is taller? Circle it.

Which post is shorter? Circle it.

LIVEWORKSHEETS

Ψηλό - κοντό

Βρες κάθε φορά το πιο κοντό



LIVEWORKSHEETS