חשב את הגבולות:

אם התשובה היא "∞", אז בתוב מילה "אינסוף",

אם התשובה היא "$-\infty$", אז בתוב מילה "- אינסוף"

	$\lim_{x \to x_0^-} f(x)$	$\lim_{x \to x_0^+} f(x)$
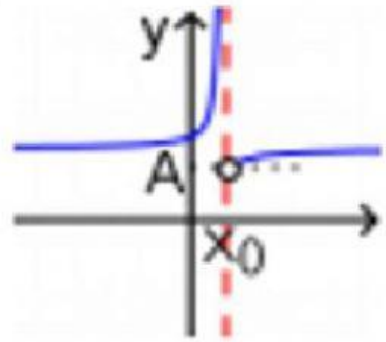		
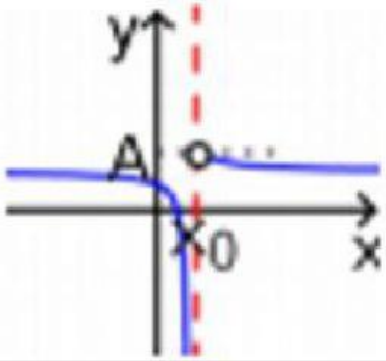		
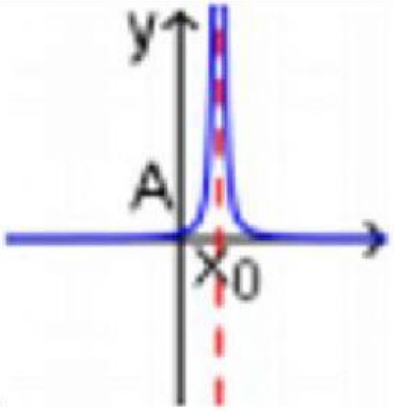		
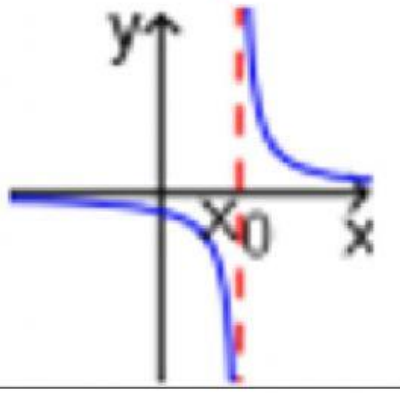		

LIVEWORKSHEETS