Division

LIVEWORKSHEETS

Division

Share the cookies equally between the children.

?

How many cookies do Bobby and Serena get each?

Bobby

Serena

LIVEWORKSHEETS

Division

Share the slices of pizza equally between the plates.

?

How many slices of pizza per plate?



LIVEWORKSHEETS

Division

Share the fish equally between the tanks.

?

How many fish per tank?

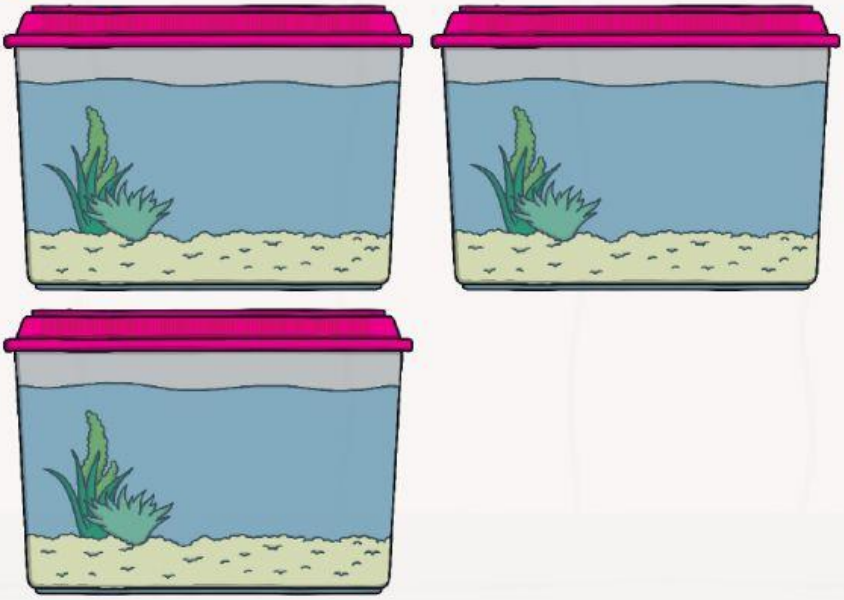



LIVEWORKSHEETS

Division

Share the fish equally between the tanks.

?

How many fish per tank now?





LIVEWORKSHEETS

Division

Share the strawberries equally between Anne and Sanjeev.

?

How many strawberries per person?

Anne

Sanjeev



LIVEWORKSHEETS

Division

Share the worms between the birds.

?

How many worms does each bird get?

Bird 1

Bird 2

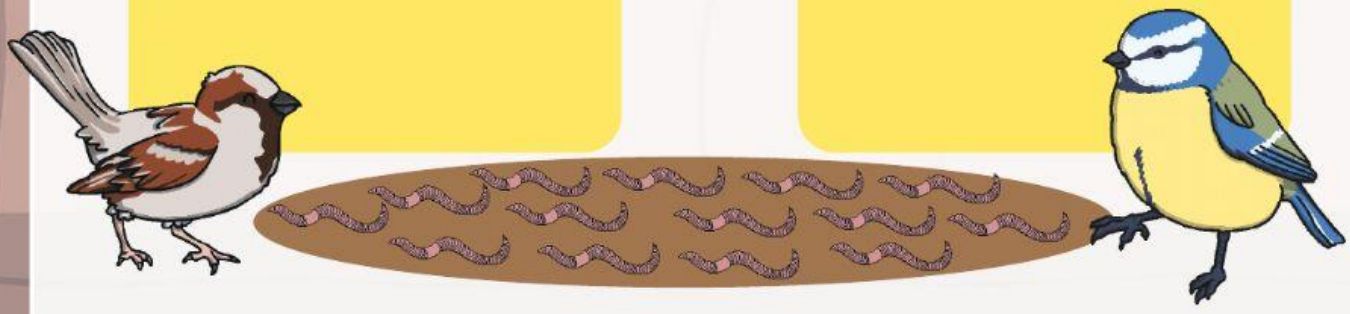

LIVEWORKSHEETS

Division

There are 40 chocolates in the box.

? How many chocolates would Mr and Mrs Gadhi each get if they are shared out equally?

Can you write the calculation?

___ ÷ ___ = ___

LIVEWORKSHEETS