ESCOLA ZILNETE PEREIRA GUIMARÃES

NOME:_____ **TURMA:** _____

1 – LIGUE OS DESENHOS A SUA FRAÇÃO.

FRAÇÃO

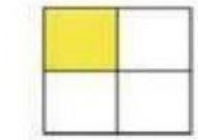

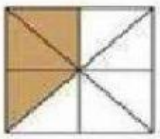



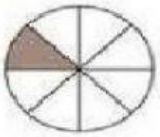

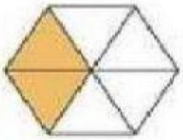

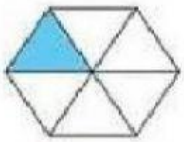

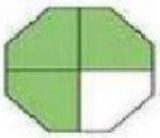



- $\frac{1}{8}$
- $\frac{2}{6}$
- $\frac{1}{4}$
- $\frac{1}{2}$
- $\frac{3}{4}$
- $\frac{1}{3}$
- $\frac{3}{8}$
- $\frac{1}{6}$

LIVEWORKSHEETS

Quadro Fracionário

- Preencha os quadros, observando as figuras de acordo com o modelo:

A	B	C	D	E
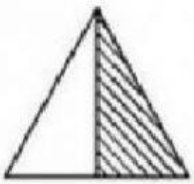	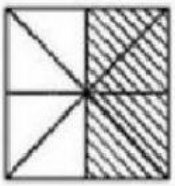			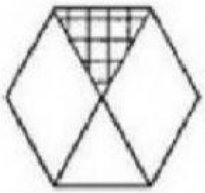

Figura	Partes pintadas	Total das partes	Fração	como se lê
A	1	2	$\frac{1}{2}$	um meio
B				
C				
D				
E				

LIVEWORKSHEETS

ESCREVA A FRAÇÃO CORRESPONDENTE:

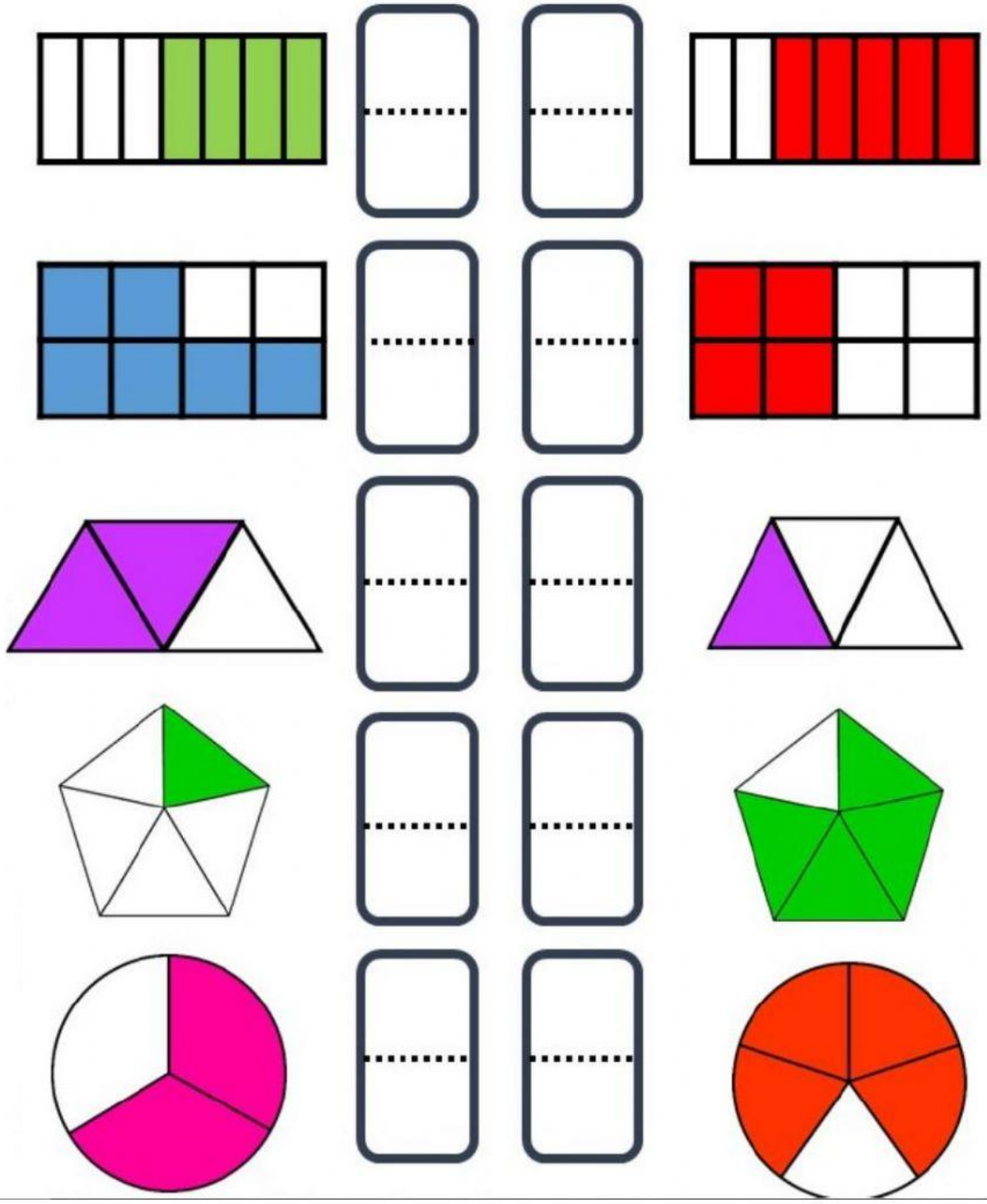

LIVEWORKSHEETS

ESCREVA COMO SE LÊ:

a) $\frac{4}{10}$ =

b) $\frac{2}{5}$ =

c) $\frac{7}{8}$ =

d) $\frac{5}{7}$ =

e) $\frac{1}{4}$ =

f) $\frac{3}{6}$ =

g) $\frac{3}{10}$ =

h) $\frac{5}{8}$ =

i) $\frac{6}{7}$ =

j) $\frac{3}{5}$ =

k) $\frac{2}{6}$ =

l) $\frac{3}{8}$ =

LIVEWORKSHEETS

ARRASTE AS FRAÇÕES CORRESTAS PARA SEUS DESENHOS.

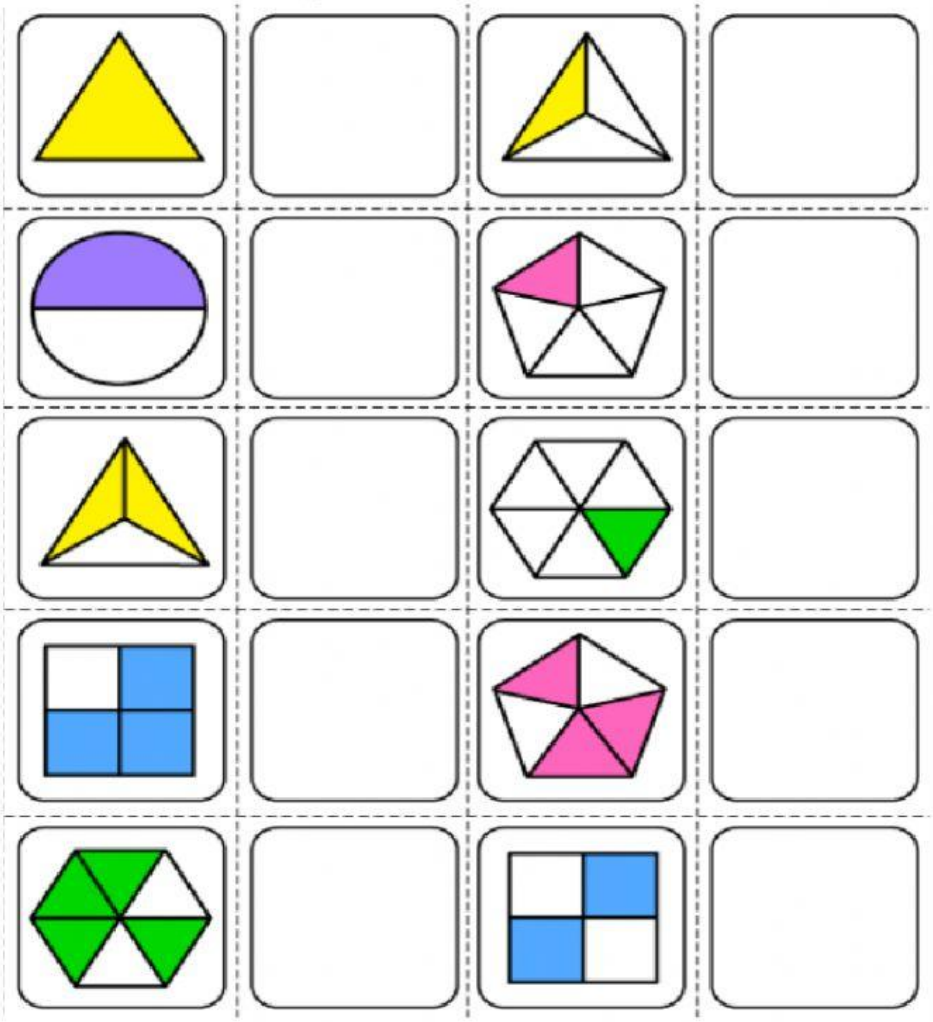

$\frac{1}{6}$ $\frac{1}{3}$ 1 $\frac{2}{3}$

$\frac{3}{5}$ $\frac{1}{5}$ $\frac{1}{2}$ $\frac{3}{4}$

$\frac{2}{4}$ $\frac{4}{6}$

LIVEWORKSHEETS