Name: Class: Date:

Patterns and Symmetry

Worksheet 1

1. Observe the pattern and hence draw House #4.

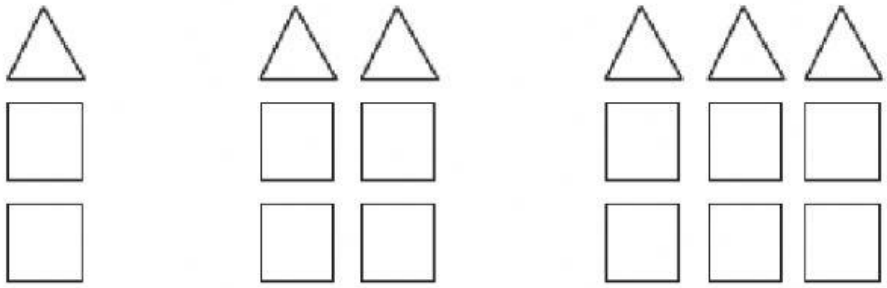

House #1 House #2 House #3

Write the number of triangles and rectangles used for House #4

2. Observe the pattern and fill in the blanks.

(a) $6 \times 3 = 18$

$60 \times 3 =$ _____

$600 \times 3 =$ _____

$6000 \times 3 =$ _____

_____ $\times 3 = 180000$

(a) $2 \div 2 = 1$

$20 \div 2 =$ _____

$200 \div$ _____ $=$ _____

$2000 \div 2 =$ _____

_____ $\div 2 = 10000$

LIVEWORKSHEETS

L2 Worksheet 1

1. Write the amount of turn as a fraction and in degrees.

Example

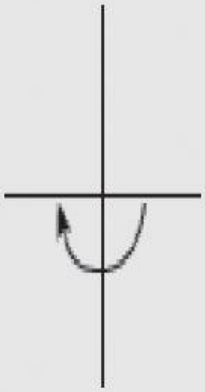

$\frac{1}{2}$ turn

180°

(a)

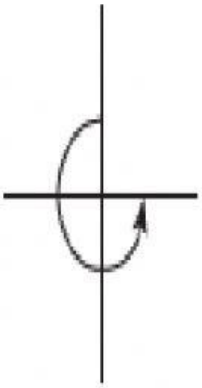

(b)

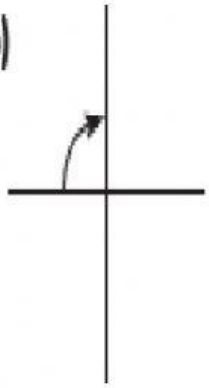

LIVEWORKSHEETS