UNITS 1-2 REVISION

Mark the correct answers with a ✔.

Look at the image and answer questions 1–3.



1 What are structures c and d?

A. Stem and roots.

B. Flower and leaves.

2 Which part is responsible for absorbing water?

A. b.

B. d.

3 Which part keeps the plant vertical?

A. c.

B. d.

LIVEWORKSHEETS

4-

Which of these is a type of seed?

A. Lentils

B. Apple

5- LOOK AT THE PICTURE:

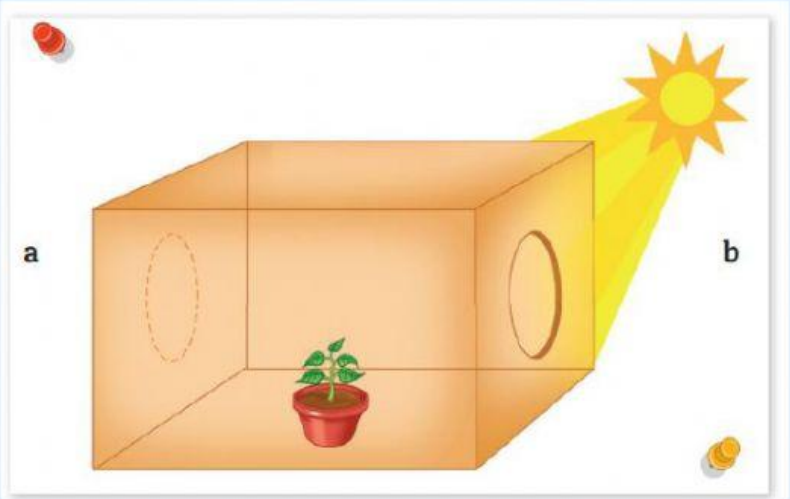

In which direction will the plant grow?

A. Toward a.

B. Toward b.

6- LOOK AT THE PICTURES:



LIVEWORKSHEETS

What type of plant is the plant in group 1?

A. A bush

B. A grass.

7-

What group is this plant part of?

A. Group 1.

B. Group 2.

8-

Which of these is a fruit?

A. Almonds

B. Sunflower seeds

LIVEWORKSHEETS

9-

Look at the images.

What characteristics do they share?

A. They are both living things.

B. They are both nonliving things.

10-

Look at the images.

Koala 1

Koala 2

Which koala is a living thing?

A. Both.

B. Only koala 1.

LIVEWORKSHEETS

11-

Look at the images.

Which of these can spend a long period of time in a sealed plastic bag?

A. The squirrel.

B. The calculator.

12-

What kind of animal is this?

A. Wild.

B. Domestic.

LIVEWORKSHEETS

13-

What kind of habitat does this animal live in?

A. Aquatic.

B. Terrestrial.

14-

According to its reproduction, how is this animal classified?

A. Viviparous.

B. Oviparous.

LIVEWORKSHEETS

15-

Which of these animals is a quadruped?

A.

B.

LIVEWORKSHEETS