Division by Sharing

Use a pencil to share these tasty goodies equally between dif ferent numbers of people.

	How many does each person get?	What does the calculation look like?
e.g. Share between 3 	(1) 2 3 4	3 ÷ 3 = (1)
a. Share between 2 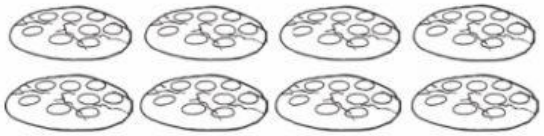	2 3 4 5	8 ÷ 2 =
b. Share between 4	2 3 4 5	12 ÷ 4 =
c. Share between 3	2 3 4 5	12 ÷ 3 =
d. Share between 5 	2 3 4 5	10 ÷5 =
e. Share between 2 	2 3 4 5	10 ÷ 2 =
f. Share between 4 	2 3 4 5	16 ÷ 4 =

LIVEWORKSHEETS