Codeyoung

Concept CW_Grade-6_Mensuration

The Perimeter of Squares and Rectangles

Find the perimeters of the following rectangles:

a)



Perimeter = ☐

b)

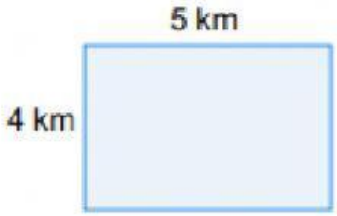

Perimeter = ☐

c)

Perimeter = ☐

d)

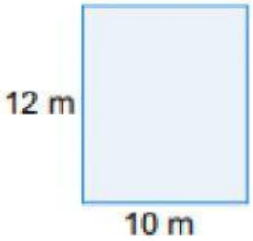

Perimeter = ☐

e)

Perimeter = ☐

f)

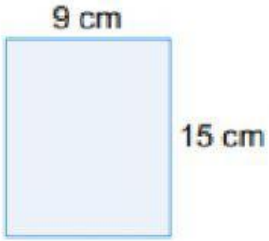

Perimeter = ☐

LIVEWORKSHEETS

Codeyoung

Find the perimeter of each square.

1)



Perimeter = ( )

2)

Perimeter = ( )

3)

Perimeter = ( )

4)

Perimeter = ( )

5)



Perimeter = ( )

6)



Perimeter = ( )

7)

Perimeter = ( )

8)



Perimeter = ( )

9)

Perimeter = ( )

LIVEWORKSHEETS