Codeyoung

Concept HW_Grade-6_Geometry

The Angle Sum Property of a Quadrilateral

Find the measure of the missing angle.

1)

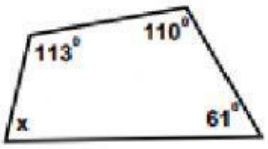

Solve for x _____

2)

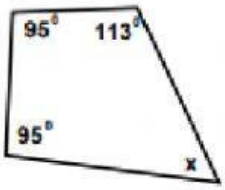

Solve for x _____

3)

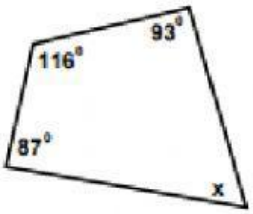

Solve for x _____

4)

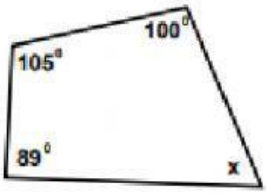

Solve for x _____

5)

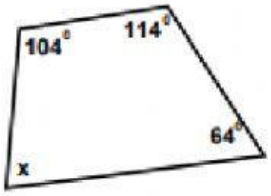

Solve for x _____

6)

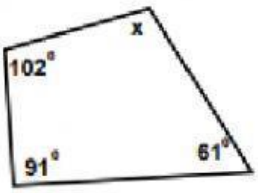

Solve for x _____

7)

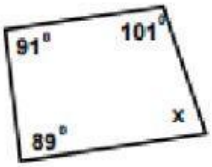

Solve for x _____

8)

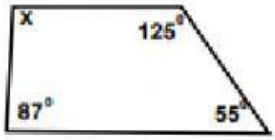

Solve for x _____

9)

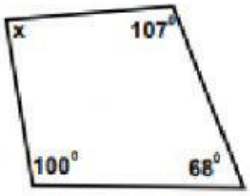

Solve for x _____

10)

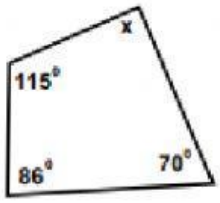

Solve for x _____

11)

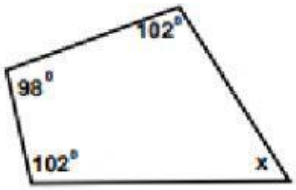

Solve for x _____

12)

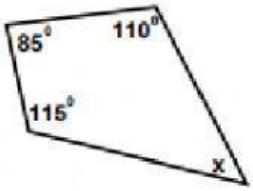

Solve for x _____

LIVEWORKSHEETS