Codeyoung

Concept HW_Grade-6_Geometry

Polyhedrons, Pyramids, and Prisms

Tick the correct box to describe the number of faces.

	Shape	Question	None	One	More than one
1)	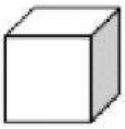	How many square faces?			
2)	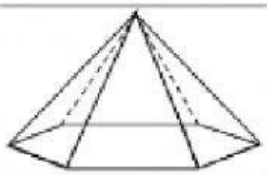	How many triangle faces?			
3)		How many rectangle faces?			
4)		How many rectangle faces?			
5)	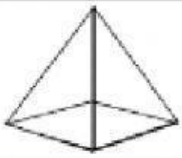	How many square faces?			
6)	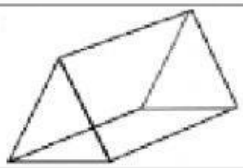	How many triangle faces?			
7)		How many triangle faces?			

LIVEWORKSHEETS