MATCHING SHAPES

Name _____

Score _____

TD16

Match the 3D names with its respective shapes.

1)

Square pyramid • • 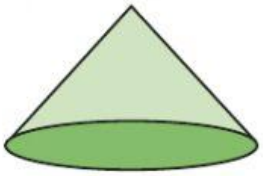

2)

Cuboid • • 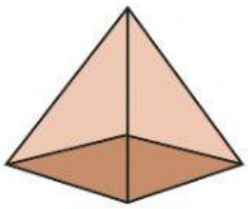

3)

Cone • • 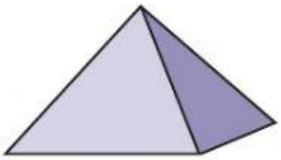

4)

Pentagonal prism • •

5)

Pyramid • • 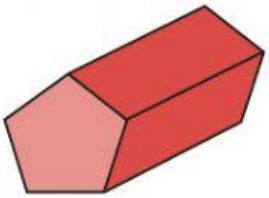

www.mathfunworksheets.com
LIVEWORKSHEETS