Number given in a picture

See how the numbers given in the pictures have been written.

Tens	Units
1	2
Twelve	

Tens	Units
	
2	8
Twenty Eight	

Tens	Units
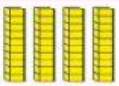	
4	7
Forty Seven	

Look at the pictures and write the numbers in words as well as in numerals.

Tens	Units

Tens	Units

Tens	Units

Write the proper number in the blank space.

Tens	Units
Twenty Six	

Tens	Units

Tens	Units

LIVEWORKSHEETS