Codeyoung

Content HW_Grade-5_Geometry

Angle Sum Property of Quadrilateral

Find the measure of the indicated angle in each quadrilateral.

1)

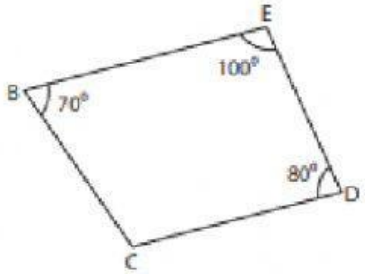

m∠C = _____

2)

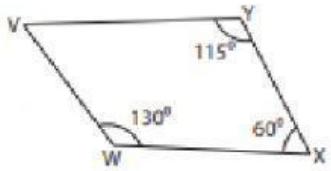

m∠V = _____

3)

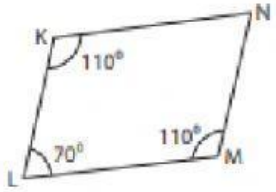

m∠N = _____

4)

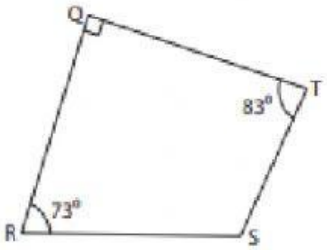

m∠S = _____

5)

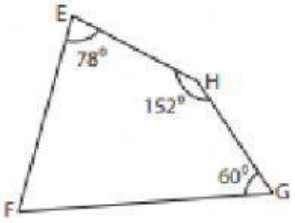

m∠F = _____

6)

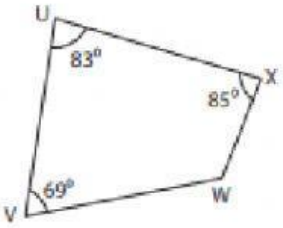

m∠W = _____

7)

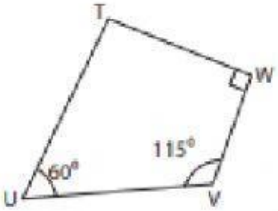

m∠T = _____

8)

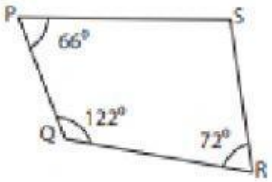

m∠S = _____

9)

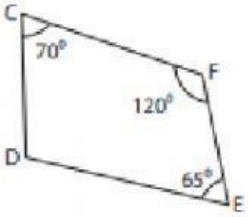

m∠D = _____

LIVEWORKSHEETS