Two Dimensional Shapes

Instruction: Answer the following questions below.

1. Which shape has 3 sides?

2. Pick all the Rectangles.



3. Which shape has more corners

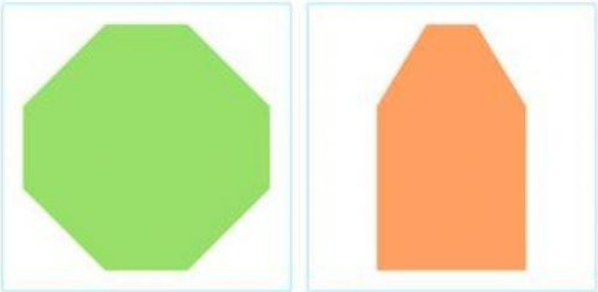

4. Pick the shape that has 6 sides



5. Which shape has 3 equal sides

LIVEWORKSHEETS