Codeyoung

Concept HW_Grade-7_Lines and Angles

Complementary and Supplementary Angles

Complementary & Supplementary Angles

Circle below, the pairs of angles which are complementary or supplementary.

20° and 70° 70° and 120° 80° and 100°

50° and 40° 75° and 15°

80° and 90° 20° and 170° 30° and 140°

30° and 70° 35° and 65°

Calculate the following missing angles.

1.

2.
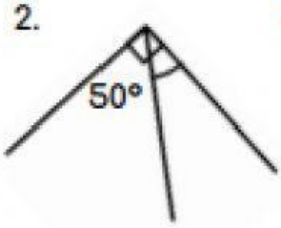

3.
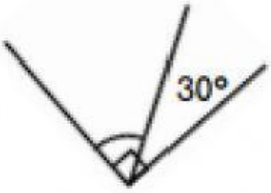

4.
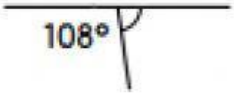

5.
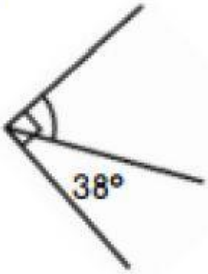

6.

7.
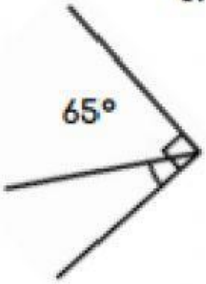

8.

State the complement & supplement of the following angles.

9. 30° 10. 70° 11. 50° 12. 80°

13. 20° 14. 40° 15. 45° 16. 65°

13. 89° 14. 73° 15. 75° 16. 36°

LIVEWORKSHEETS