Codeyoung

Concept CW_Grade-6_Geometry

The Angle Sum Property of a Triangle

Triangle Angle Sum

Solve for the given variable.

1) 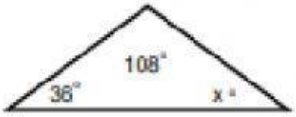

x = ____

2) 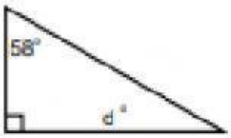

d = ____

3) 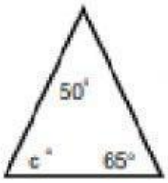

c = ____

4) 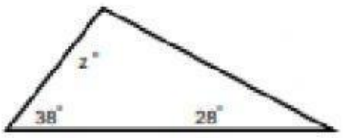

z = ____

5) 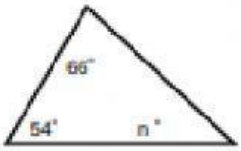

n = ____

6) 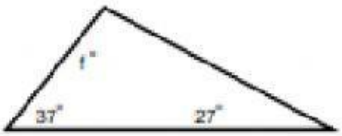

f = ____

7) 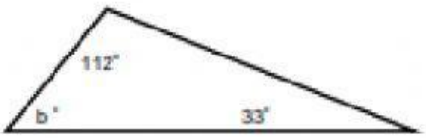

b = ____

8) 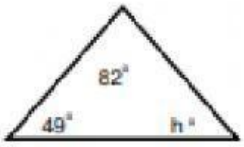

h = ____

LIVEWORKSHEETS