Codeyoung

Advanced_Grade-6_Geometry

The Angle Sum Property of a Triangle

Solve for x.

1)

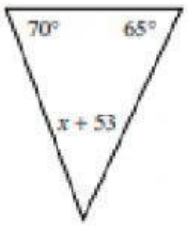

A) −12 B) −8
C) −10 D) −5

2)

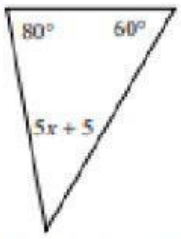

A) −8 B) −6
C) 7 D) −1

3)

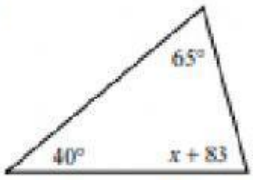

A) −8 B) −4
C) −6 D) −10

4)

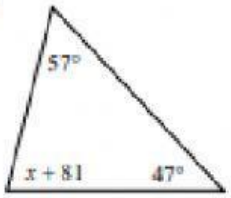

A) −5 B) 8
C) 9 D) 5

5)

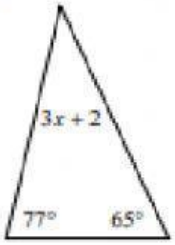

A) 4 B) −12
C) 12 D) −7

6)

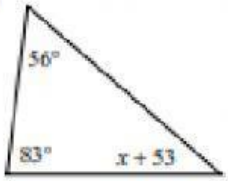

A) 5 B) −12
C) −8 D) 12

7)

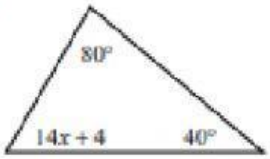

A) −3 B) 4
C) −10 D) −11

8)

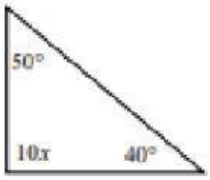

A) −4 B) 9
C) −8 D) 6

LIVEWORKSHEETS

Codeyoung

LIVEWORKSHEETS