Codeyoung

Application_Grade-6_Geometry

Parallel Lines, Transversals, and Angle Pairs

Find the value of x.

1)

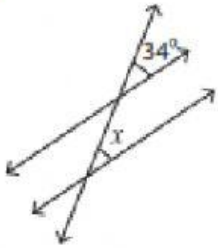

$x =$ _____

2)

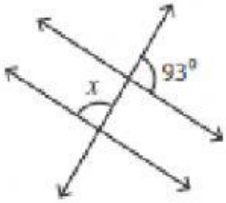

$x =$ _____

3)

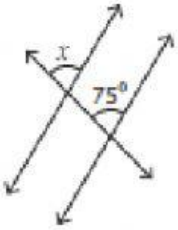

$x =$ _____

4)

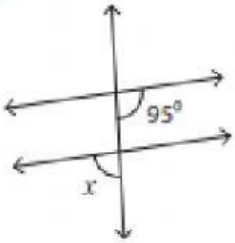

$x =$ _____

5)

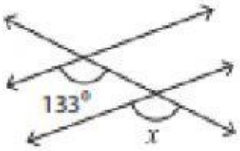

$x =$ _____

6)

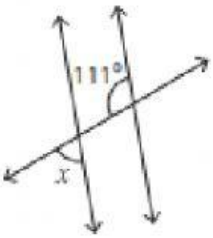

$x =$ _____

7)

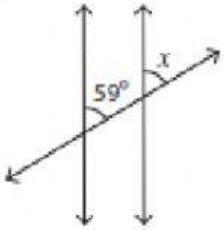

$x =$ _____

8)

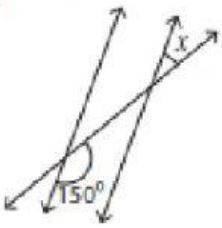

$x =$ _____

9)

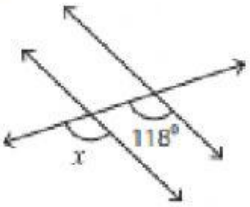

$x =$ _____

LIVEWORKSHEETS