Codeyoung

Concept CW_Grade-3_Measurement

A Recap to Measurement and Comparison of Lengths (in cm)

Q1) Measure the figures in Centimetres.

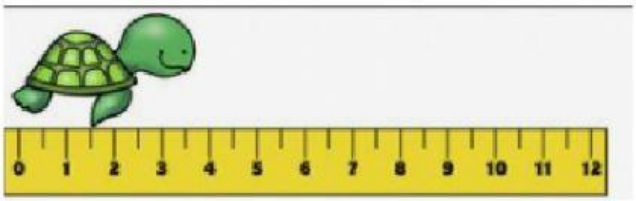

= _____ cm

= _____ cm

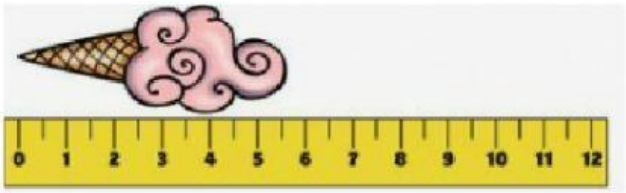

= _____ cm



= _____ cm

LIVEWORKSHEETS

Codeyoung

= _____ cm

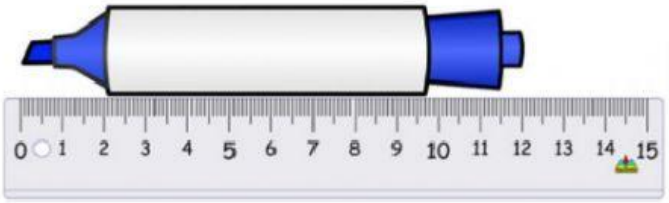

= _____ cm

LIVEWORKSHEETS